[This question paper contains 40 printed pages.]

Your Roll No.....

Sr. No. of Question Paper : 3495 **A**

Unique Paper Code : 12271403

Name of the Paper : Introductory Econometrics

Name of the Course : **CBCS Core**

Semester : IV

Duration : 3 Hours Maximum Marks : 75

Instructions for Candidates

1. Write your Roll No. on the top immediately on receipt of this question paper.

2. Answer any **Five** questions out of **Seven**.

3. **All** questions carry equal marks.

4. Use of simple non-programmable calculator is allowed. Statistical tables are attached for your reference. Numbers may be rounded off to two decimal places for all calculations.

5. Answers may be written either in English or Hindi; but the same medium should be used throughout the paper.

P.T.O.

छात्रों के लिए निर्देश

1. इस प्रश्न-पत्र के मिलते ही ऊपर दिए गए निर्धारित स्थान पर अपना अनुक्रमांक लिखिए ।

2. सात में से किन्हीं पाँच प्रश्नों के उत्तर दीजिए ।

3. सभी प्रश्नों के अंक समान हैं ।

4. साधारण गैर-प्रोग्राम योग्य कैलकुलेटर के उपयोग की अनुमति है । आपके संदर्भ के लिए सांख्यिकीय सारणियां संलग्न हैं । सभी गणनाओं के लिए दो दशमलव स्थानों पर संख्याओं को गोल किया जा सकता है ।

5. इस प्रश्न-पत्र का उत्तर अंग्रेजी या हिंदी किसी एक भाषा में दीजिए, लेकिन सभी उत्तरों का माध्यम एक ही होना चाहिए ।

1. State whether the following statements are True or False. Justify your answer.

(i) In linear regression models, r^2 value is invariant to changes in the unit of measurement, as it is dimensionless.

(ii) An addition of a variable in a regression model with 30 observations and 4 variables, would always lead to a rise in the R^2 and adjusted R^2, given that the additional variable is statistically significantly different from zero at α=20%.

(iii) In the regression involving standardized variables, the intercept term is always zero.

(iv) The correlation coefficient between U = 3X+2 and V= -4Y+5 is the same as between X and Y.

(v) In a multiple regression model $Y_i = \beta_1 + \beta_2 X_{2i} + \beta_3 X_{3i} + u_i$, testing a joint restriction $H_0: \beta_2 = \beta_3 = 0$ is same as testing for $H_0: \beta_2 = 0$ and $H_0: \beta_3 = 0$.

(5×3=15)

1. बताएं कि निम्नलिखित कथन सही हैं या गलत। अपने जवाब का औचित्य साबित कीजिये।

(i) रैखिक प्रतिगमन मॉडल में, R^2 मान माप इकाई में परिवर्तन के लिए अपरिवर्तनीय है, क्योंकि यह आयाम रहित है।

(ii) 30 अवलोकनों और 4 चरों के साथ प्रतिगमन मॉडल में एक चर के अतिरिक्त, हमेशा R^2 और समायोजित R^2 में वृद्धि की ओर ले जाएगा, यह देखते हुए कि अतिरिक्त चर α = 20% पर शून्य से सांख्यिकीय रूप से महत्वपूर्ण रूप से भिन्न है।

(iii) मानकीकृत चर वाले प्रतिगमन में, अवरोधन शब्द हमेशा शून्य होता है।

(iv) U = 3X+2 और V= -4Y+5 के बीच सहसंबंध गुणांक वही है जो X और Y के बीच है।

(v) एकाधिक प्रतिगमन मॉडल $Y_i = \beta_1 + \beta_2 X_{2i} + \beta_3 X_{3i} + u_i$ में, एक संयुक्त प्रतिबंध $H_0: \beta_2 = \beta_3 = 0$ का परीक्षण $H_0: \beta_2 = 0$ और $H_0: \beta_3 = 0$ के परीक्षण के समान है। (5×3=15)

2. (a) Consider the model

$$Y_i = \beta_1 + \beta_2 X_{2i} + \beta_3 X_{3i} + u_i$$

where,

Y_i is the long term consumption measured in Rs thousands

X_{2i} is the income measured in Rs thousands

X_{3i} is the age measured in years

(i) How will the estimated intercept and slope coefficients change if the unit of measurement of income is changed to Rs lakhs.

(ii) Suppose the researcher thinks that usually consumption increases with income but at a decreasing rate and consumption increases with age. How would he modify the model to see whether the data supports his hypothesis?.

(iii) Suppose the researcher wants to assess the relative importance of age and income on long term consumption, what model should he estimate? Explain.

(3+2+2)

(b) Let X_2 be the hours spent on Mathematics coaching during a week, X_3 be the time spent on studying other subjects and Y be the scores obtained in the mathematics final exam. The following summations for 23 students were obtained as below:

$\bar{X}_2 = 10, \bar{X}_3 = 5, \bar{Y} = 12$ n=23

$\sum x_2^2 = 12, \sum x_2x_3 = 8, \sum x_3^2 = 12, \sum x_2y = 10, \sum x_3y = 8, \sum y^2 = 10$

x_2, x_3 and y are variables measured in deviation form.

(i) Estimate the following regression $Y_i = \beta_1 + \beta_2 X_{2i} + \beta_3 X_{3i} + u_i$

(ii) Estimate the standard errors of the slope coefficients.

(iii) Obtain R^2 of the regression.

(iv) Interpret the slope coefficients and comment on their statistical significance.

(2+3+1+2)

2. (क) मॉडल पर विचार कीजिये:

$$Y_i = \beta_1 + \beta_2 X_{2i} + \beta_3 X_{3i} + u_i$$

जहाँ पर,

Y_i हजारों रुपये में मापी गई लंबी अवधि की खपत है

X_{2i} हजारों रुपये में मापी गई आय है

X_{3i} वर्षों में मापी गई आयु है

(i) यदि आय की माप की इकाई को लाख रुपये में बदल दिया जाए तो अनुमानित अवरोधन और ढलान गुणांक कैसे बदलेंगे।

(ii) मान लीजिए कि शोधकर्ता सोचता है कि आम तौर पर आय के साथ खपत बढ़ती है लेकिन घटती दर पर और खपत उम्र के साथ बढ़ती है। वह यह देखने के लिए मॉडल को कैसे संशोधित करेगा कि डेटा उसकी परिकल्पना का समर्थन करता है या नहीं?

(iii) मान लीजिए कि शोधकर्ता लंबी अवधि के उपभोग पर उम्र और आय के सापेक्ष महत्व का आकलन करना चाहता है, तो उसे किस मॉडल का अनुमान लगाना चाहिए? व्याख्या कीजिये। (3+2+2)

(ख) मान लीजिये X_2 एक सप्ताह के दौरान गणित की कोचिंग पर बिताए गए घंटे हैं, X_3 अन्य विषयों के अध्ययन में बिताया गया समय है और Y गणित की अंतिम

परीक्षा में प्राप्त अंक हैं। 23 छात्रों के लिए निम्नलिखित सारांश निम्नानुसार प्राप्त किए गए थे:

$\bar{X}_2 = 10, \bar{X}_3 = 5, \bar{Y} = 12$ n=23

$$\sum x_2^2 = 12, \sum x_2x_3 = 8, \sum x_3^2 = 12, \sum x_2y = 10, \sum x_3y = 8, \sum y^2 = 10$$

X_2, X_3 और y विचलन रूप में मापे गए चर हैं।

(i) निम्नलिखित प्रतिगमन का अनुमान लगाएं $Y_i = \beta_1 + \beta_2 X_{2i} + \beta_3 X_{3i} + u_i$

(ii) ढलान गुणांक की मानक त्रुटियों का अनुमान लगाएं।

(iii) प्रतिगमन के R^2 प्राप्त कीजिये।

(iv) ढलान गुणांक की व्याख्या कीजिये और उनके सांख्यिकीय महत्व पर टिप्पणी कीजिये। (2+3+1+2)

3. a) An individual is hired to determine the best location for the next branch of a famous family restaurant chain 'Foodies'. The individual decides to build a regression model to explain the gross sales volume at each of the restaurants in the chain as a function of various descriptors of the location of that branch: He considers the following regression (original):

$$\hat{Y}_i = 102{,}192 - 9075\, N_i + 0.3547 P_i + 1.288\, I_i$$
$$\text{se} = \qquad (2053) \quad (0.0727) \quad (0.543)$$
$$n = 22 \quad R^2 = 0.579 \quad RSS = 384.27$$

where Y = gross sales volume, N = the number of competitive restaurants nearby, P = the population nearby, and I = the average household income nearby.

(i) Interpret the slope coefficients of the regression and R^2.

(ii) Suppose we add another variable A to the regression above where A = address of the restaurant. Consider the modified regression given below:

$$\hat{Y}_i = 98{,}125 - 8975\, N_i + 0.360\, P_i + 1.301\, I_i + 58.07\, A_i$$
$$\text{se} = \qquad (2082) \quad (0.074) \quad (0.550) \quad (95.21)$$
$$n = 22 \quad R^2 = 0.695$$

Do you think adding a new variable A has improved the fit of the equation? Why/Why not?

(iii) Do you suspect a problem in part (ii) above? What is the problem and what could be the consequences of the problem? How will you correct for the problem?

(iv) How do you conduct Ramsey RESET test to check for the likelihood of specification error in the model?

(v) Suppose the average household income (I) is not measured correctly. What are the consequences of this on the properties of the OLS estimators? (2+2+3+3+2)

b) The following regression is run on 240 observations.

$$Y_i = \beta_1 + \beta_2 X_{2i} + \beta_3 X_{3i} + \beta_4 X_{4i} + u_i$$

The residuals obtained have respective skewness and kurtosis values - 0.097 and 2.56.

On the basis of the given information, how would you test the Normality assumption of residuals. State the Null and Alternative hypotheses. Do you think that the test is valid if the regression is run on 10 observations? (2+1)

3. क) एक प्रसिद्ध पारिवारिक रेस्तरां श्रृंखला 'फूडीज़' की अगली शाखा के लिए सर्वोत्तम स्थान निर्धारित करने के लिए एक व्यक्ति को काम पर रखा जाता है। व्यक्ति उस शाखा के स्थान के विभिन्न विवरणकों के कार्य के रूप में श्रृंखला के प्रत्येक रेस्तरां में सकल बिक्री की मात्रा की व्याख्या करने के लिए एक प्रतिगमन मॉडल बनाने का निर्णय लेता है। वह निम्नलिखित प्रतिगमन (मूल) पर विचार करता है:

$$\hat{Y}_i = 102{,}192 - 9075\, N_i + 0.3547 P_i + 1.288\, I_i$$
$$\text{se} = \quad (2053) \quad (0.0727) \quad (0.543)$$
$$n = 22 \quad R^2 = 0.579 \quad RSS = 384.27$$

जहाँ Y = सकल बिक्री की मात्रा, N = आस-पास के प्रतिस्पर्धी रेस्तरां की संख्या,

P = आस-पास की जनसंख्या, और I = आस-पास की औसत घरेलू आय।

(i) प्रतिगमन और R^2 के ढलान गुणांक की व्याख्या कीजिये।

(ii) मान लीजिए कि हम ऊपर के प्रतिगमन में एक और चर A जोड़ते हैं जहां A = रेस्तरां का पता। नीचे दिए गए संशोधित प्रतिगमन पर विचार कीजिये:

$$\hat{Y}_i = 98{,}125 - 8975\, N_i + 0.360\, P_i + 1.301\, I_i + 58.07\, A_i$$
$$\text{se} = \quad (2082) \quad (0.074) \quad (0.550) \quad (95.21)$$
$$n = 22 \quad R^2 = 0.695$$

क्या आपको लगता है कि एक नया चर A जोड़ने से समीकरण के फिट में सुधार हुआ है? क्यों, क्यों नहीं?

(iii) क्या आपको उपरोक्त भाग (ii) में किसी समस्या का संदेह है? समस्या क्या है और समस्या के परिणाम क्या हो सकते हैं? आप समस्या को कैसे ठीक करेंगे?

(iv) मॉडल में विनिर्देश त्रुटि की संभावना की जांच के लिए आप रैमसे रीसेट परीक्षण (Ramsey RESET Test) कैसे आयोजित करते हैं?

(v) मान लीजिए कि औसत घरेलू आय (I) को सही ढंग से नहीं मापा जाता है। इसका OLS अनुमानकों के गुणों पर क्या प्रभाव पड़ता है? (2+2+3+3+2)

ख) निम्नलिखित समाश्रयण 240 प्रेक्षणों पर चलाया जाता है।

$$Y_i = \beta_1 + \beta_2 X_{2i} + \beta_3 X_{3i} + \beta_4 X_{4i} + u_i$$

प्राप्त अवशेषों में संबंधित तिरछापन (skewness) और कर्टोसिस (kurtosis) मान -0.097 और 2.56 है। दी गई जानकारी के आधार पर, आप अवशिष्टों की सामान्यता धारणा का परीक्षण कैसे करेंगे। शून्य और वैकल्पिक परिकल्पनाओं का उल्लेख कीजिए। क्या आपको लगता है कि परीक्षण मान्य है यदि प्रतिगमन 10 अवलोकनों पर चलाया जाता है? (2+1)

4. a) A regression equation includes a quantitative dependent variable (Y= wages), a quantitative independent variable (X=years of experience) and two qualitative variables; Gender and Education Level with two categories each; Male & Female; and Graduate & not a Graduate. Assume that the qualitative variables do not interact with each other.
   (i) Using intercept dummy variables, write the wage regression model if the impact of years of experience, gender and education level is to be analyzed on wages (use Female Graduate as the reference category). Write the estimated equation for Male Graduate category.
   (ii) How would answer in part (i) be changed if the Educational Level has three categories instead, namely; Graduate, Post-Graduate & Ph.D.
   (iii) Based on part (ii), write the wage equation for the two specific categories, (a) Female with Ph.D. (b) Male Post-Graduates.
   (iv) How would the model in part (ii) be modified if the objective is to examine whether the marginal effect of experience is gender-specific?
   (v) How would the regression in part (i) be modified if qualitative variables interact with each other? (2+2 +2+2+2)

b) A random sample of 200 vehicles traveling on rough roads with a posted speed limit of 35 mph on such roads resulted in a sample mean speed of 37.5 mph and a sample standard deviation of 8.6 mph, whereas another random sample of 200 vehicles with a posted speed limit of 55 mph resulted in a sample mean and sample standard deviation of 35.8 mph and 9.2 mph, respectively. carry out a test at 10% significance level to decide whether the two population distribution variances are identical. (5)

4. क) प्रतिगमन समीकरण में एक मात्रात्मक आश्रित चर (Y= मजदूरी), एक मात्रात्मक स्वतंत्र चर (X=वर्ष का अनुभव) और दो गुणात्मक चर लिंग और शिक्षा स्तर शामिल हैं; प्रत्येक की दो श्रेणियाँ हैं; पुरुष अथवा महिला और ग्रेजुएट अथवा ग्रेजुएट नहीं। मान लीजिये कि दोनों गुणात्मक चर एक दुसरे को प्रभावित नहीं करते।

(i) अवरोधन मूक चर (intercept dummy variables) का उपयोग करते हुए, मजदूरी का रिग्रेशन मॉडल लिखिए, यदि वेतन पर वर्षों के अनुभव, लिंग और शिक्षा स्तर के प्रभाव का

विश्लेषण किया जाता है (संदर्भ श्रेणी के रूप में महिला स्नातक का उपयोग कीजिये)। पुरुष स्नातक श्रेणी के लिए अनुमानित समीकरण लिखिए।

(ii) यदि शैक्षिक स्तर में बजाय तीन श्रेणियां हैं, अर्थात्; ग्रेजुएट, पोस्ट ग्रेजुएट अथवा पीएचडी तब भाग (i) में उत्तर कैसे बदलेगा?

(iii) भाग (ii) के आधार पर, दो विशिष्ट श्रेणियों के लिए वेतन समीकरण लिखिए, (क) पीएच.डी. के साथ महिला (ख) पुरुष स्नातकोत्तर।

(iv) यदि उद्देश्य यह जांचना है कि क्या अनुभव का सीमांत प्रभाव लिंग-विशिष्ट है, तो भाग (ii) में मॉडल को कैसे संशोधित किया जाएगा?

(v) यदि गुणात्मक चर एक दूसरे के साथ परस्पर क्रिया करते हैं, तो भाग (i) में प्रतिगमन को कैसे संशोधित किया जाएगा? (2+2+2+2+2)

ख) 200 वाहनों के एक यादृच्छिक नमूना जिसका 35 मील प्रति घंटे की गति सीमा के साथ उबड़-खाबड़ सड़कों पर यात्रा करने पर परिणामस्वरूप नमूना औसत गति 37.5 मील प्रति घंटे और नमूना मानक विचलन 8.6 मील प्रति घंटे पाया जाता है, जबकि 200 वाहनों का एक और यादृच्छिक नमूना है जिसका 55 मील प्रति घंटे की गति सीमा के परिणामस्वरूप क्रमशः नमूना माध्य 35.8 मील प्रति घंटे और नमूना मानक विचलन 9.2 मील प्रति घंटे पाया जाता है। 10% महत्व स्तर पर एक परीक्षण कीजिये कि दो जनसंख्या वितरण भिन्नताएं समान हैं या नहीं। (5)

5. Quarterly data on country XYZ was collected for the period 2005-2019 to estimate the relation between foreign direct investment (FDI), trade openness (TO), gross domestic product (GDP) and exchange rate (E). TO is defined as ratio of export plus imports to GDP and t = trend. Following regression was estimated:

$$FDI_t = -0.58 + 0.012\,E_t - 0.025\,TO_t + 0.006\,GDP_t + 0.34\,t$$

$$se = (0.097) \quad (0.013) \quad (0.004) \quad (0.015) \quad (0.09)$$

$$R^2 = 0.904 \quad d = 1.45$$

(i) Interpret the estimated slope coefficients. Do you suspect some problem with the above regression?

(ii) What is the nature of the problem? How do you know? Explain its consequences?

$\frac{FDI_t}{GDP_t} = \beta_0 + \beta_1 \frac{E_t}{GDP_t} + \beta_2 \frac{TO_t}{GDP_t} + \beta_3 \frac{t}{GDP_t} + u_t$. Will this transformation solve the problem mentioned in (ii) above? How? Can you compare R^2 of this model with the model above?

(iii)Suppose now the regression is estimated as given below:

$$\widehat{FDI_t} = -0.74 - 0.042\,TO_t + 0.41t$$

se = (0.057) (0.019) (0.364)

$R^2 = 0.896$ d=1.34

Test whether the regression specified above suffers from first order autocorrelation? Which test will you use and why? (Use $\alpha = 5\%$)

(iv)If the errors obtained from regression specified in (iii) above follows higher order autoregressive process then how would you test for serial correlation? Give the steps of the test in detail.

(v) With reference to the regression specified in part (iii). What will be the remedy for the problem of autocorrelation if it is detected? Explain.

(2+3+3+3+4)

5. देश XYZ पर 2005-2019 की अवधि के लिए त्रैमासिक डेटा प्रत्यक्ष विदेशी निवेश (FDI), व्यापार खुलापन (TO), सकल घरेलू उत्पाद (GDP) और विनिमय दर (E) के बीच संबंध का अनुमान लगाने के लिए एकत्र किया गया था। TO को निर्यात और आयात के अनुपात के रूप में परिभाषित किया गया है और t = प्रवृत्ति। निम्नलिखित प्रतिगमन का अनुमान लगाया गया था:

$$\widehat{FDI_t} = -0.58 + 0.012\,E_t - 0.025\,TO_t + 0.006\,GDP_t + 0.34\,t$$

se = (0.097) (0.013) (0.004) (0.015) (0.09)

$R^2 = 0.904$ d=1.45

(i) अनुमानित ढलान गुणांक की व्याख्या कीजिये। क्या आपको उपरोक्त प्रतिगमन के साथ कुछ समस्या का संदेह है?

(ii) समस्या की प्रकृति क्या है? आपको कैसे मालूम? इसके दुष्परिणाम बताएं?

$\frac{\widehat{FDI_t}}{GDP_t} = \beta_0 + \beta_1 \frac{E_t}{GDP_t} + \beta_2 \frac{TO_t}{GDP_t} + \beta_3 \frac{t}{GDP_t} + u_t$. क्या यह परिवर्तन उपरोक्त (ii) में उल्लिखित समस्या का समाधान करेगा? कैसे? क्या आप इस मॉडल के R^2 की तुलना उपरोक्त मॉडल से कर सकते हैं?

(iii) मान लीजिए कि अब प्रतिगमन का अनुमान नीचे दिया गया है:

$$\widehat{FDI_t} = -0.74 - 0.042\,TO_t + 0.41t$$

se = (0.057) (0.019) (0.364)

$R^2 = 0.896$ d=1.34

परीक्षण कीजिये कि क्या ऊपर निर्दिष्ट प्रतिगमन पहले क्रम के स्वतः सहसंबंध से ग्रस्त है? आप किस परीक्षण का उपयोग करेंगे और क्यों? (α = 5% का प्रयोग कीजिये)

(iv) यदि उपरोक्त (iii) में निर्दिष्ट प्रतिगमन से प्राप्त त्रुटियां उच्च क्रम ऑटोरेग्रेसिव (AR) प्रक्रिया का पालन करती हैं तो आप सीरियल सहसंबंध के लिए कैसे परीक्षण करेंगे? परीक्षण के चरणों का विस्तार से वर्णन कीजिए।

(v) भाग (iii) में निर्दिष्ट प्रतिगमन के संदर्भ में, स्वसहसंबंध की समस्या का पता चलने पर उसका क्या उपाय होगा? समझाइये। (2+3+3+3+4)

6. a) The Home Ministry of a country wants to test if petty crimes (minor thefts) are higher in states where poverty rates are high. They obtain data on several variables and ran the following cross section regression for 35 states in the country.

$$C_i = 6.275 + 0.1147\, PR_i - 0.0712\, LR_i + 0.0862\, SDP_i$$

Se = (3.125) (0.02713) (0.0361) (0.03834)

n = 35 R = 0.6876

where C = Crimes per lakh of population

PR = poverty rates

LR = Literacy rate

SDP = State Domestic Product

(i) A priori what signs are expected for the explanatory variables? Explain your answers.

(ii) Test for overall goodness of fit of the regression (Use α = 5%)

(iii) Another model was also used and following results were obtained:

$$\ln C_i = 2.142 + 0.01186\, lnPR_i - 0.0548\, lnLR_i + 0.0921\, lnSDP_i$$

Se = (1.102) (0.0673) (0.0259) (0.03647)

n = 35 R^2 = 0.7923

Interpret the coefficient of ln SDP.

(iv) How will you conduct MacKinnon-White-Davidson (MWD) test to select which model is better? Write all steps clearly. (2+2+2+3)

b) The regression equation given in part (a) is modified as follows:

$$\hat{C}_i = 23.83 - 0.0089\, LR_i$$

This equation was estimated using 50 cross-sectional observations on states, by ordinary least squares (OLS). To check for heteroscedasticity related to LR, separate regressions were run for the 17 states with the lowest LR and the 17 states with the highest LR. The sum of

squared residuals for the low LR states was 270. The sum of squared residuals for the high-LR states was 90.

(i) Compute unbiased estimates of the variance of the error term in the two subsamples.

(ii) Conduct the Goldfeld-Quandt test at 5% level of significance.

(iii) Regardless of your conclusion for part (ii), suppose you believe that heteroscedasticity is indeed present and that the variance of the error term is inversely proportional to state LR: $Var(\varepsilon_i) = \gamma / LR_i$, where γ = an unknown constant. Explain how you would transform the data to satisfy the classical assumptions. (2*3=6)

6. क) किसी देश का गृह मंत्रालय यह जांचना चाहता है कि क्या छोटे अपराध (मामूली चोरी) उन राज्यों में अधिक हैं जहां गरीबी दर अधिक है। वे कई चरों पर डेटा प्राप्त करते हैं और देश के 35 राज्यों के लिए निम्नलिखित क्रॉस सेक्शन प्रतिगमन का अनुमान लगते हैं:

$$C_i = 6.275 + 0.1147\, PR_i - 0.0712\, LR_i + 0.0862\, SDP_i$$

Se = (3.125) (0.02713) (0.0361) (0.03834)

n = 35 R = 0.6876

जहाँ C = प्रति लाख जनसंख्या पर अपराध

PR = गरीबी दर

LR = साक्षरता दर

SDP = राज्य घरेलू उत्पाद

(i) एक प्राथमिकता व्याख्यात्मक चर के लिए क्या संकेत अपेक्षित हैं? अपने उत्तरों की व्याख्या कीजिये।

(ii) प्रतिगमन के फिट की समग्र अच्छाई के लिए परीक्षण कीजिये। (α = 5% का प्रयोग कीजिये)

(iii) एक अन्य मॉडल का भी उपयोग किया गया और निम्नलिखित परिणाम प्राप्त हुए:

$$\ln C_i = 2.142 + 0.01186\, lnPR_i - 0.0548\, lnLR_i + 0.0921\, lnSDP_i$$

$Se = (1.102) \quad (0.0673) \quad (0.0259) \quad (0.03647)$
$n = 35 \quad R^2 = 0.7923$

In एसडीपी के गुणांक की व्याख्या कीजिये।

(iv) कौन सा मॉडल बेहतर है यह चुनने के लिए आप मैकिनॉन-व्हाइट-डेविडसन (MWD) परीक्षण कैसे करेंगे? सभी चरणों को स्पष्ट रूप से लिखिए। (2+2+2+3)

ख) भाग (क) में दिए गए प्रतिगमन समीकरण को निम्नानुसार संशोधित किया गया है:

$$\hat{C}_i = 23.83 - 0.0089\, LR_i$$

सामान्य न्यूनतम वर्गों (OLS) द्वारा राज्यों पर 50 क्रॉस-सेक्शनल अवलोकनों का उपयोग करके इस समीकरण का अनुमान लगाया गया था। LR से संबंधित विषमलैंगिकता (heteroscedasticity) की जाँच करने के लिए, सबसे कम LR वाले 17 राज्यों और उच्चतम LR वाले 17 राज्यों के लिए अलग-अलग प्रतिगमन अनुमान लगाए गए थे। निम्न LR राज्यों के लिए वर्ग अवशिष्टों का योग 270 था। उच्च-LR राज्यों के लिए वर्ग अवशिष्टों का योग 90 था।

(i) दो उप-नमूनों में त्रुटि पद के विचरण के निष्पक्ष अनुमानों की गणना कीजिये।

(ii) गोल्डफेल्ड-क्वांड्ट परीक्षण को 5% महत्व के स्तर पर आयोजित कीजिये।

(iii) भाग (ii) के लिए आपके निष्कर्ष के बावजूद, मान लीजिए कि विषमलैंगिकता वास्तव में मौजूद है और त्रुटि का विचरण राज्य LR के व्युत्क्रमानुपाती है: $Var(\varepsilon_i) = \gamma/_{LR_i}$, जहां γ = एक अज्ञात लगातार। स्पष्ट कीजिये कि आप शास्त्रीय मान्यताओं को संतुष्ट करने के लिए डेटा को कैसे रूपांतरित करेंगे। (2*3=6)

7. a) The estimated equation for sales of TV is as given below:

$$Sales = 118.91 - 7.908\, Price + 1.863\, Advert$$
$$(se) = (6.35) \quad (1.096) \quad (0.683) \qquad R^2 = 0.448,\ n=30$$

where Price is price of TV measured in Rs.
Sales is sale revenue and Advert is advertising expenditure. Both Sales and Advert are measured in terms of thousands of rupees.

(i) Is the slope coefficient of price statistically different from 1? Test at α=2%.
(ii) Calculate the elasticity of sales revenue with respect to price if average sales revenue is 300 and average price is 100?

(iii) How would you test that an increase in advertising expenditure will bring an increase in sales revenue that is sufficient to cover the increased advertising expenditure? Clearly state the null and alternative hypotheses. Test at $\alpha=5\%$

(iv) Estimate the sales revenue for a price of Rs 6 and an advertising expenditure of Rs 1,200. (3+2+3+2)

b) Consider the following regression $Y_t = \beta_1 X_t + \mu_t$ where $\tilde{\beta}_1$ is the OLS estimator of β_1.

(i) Find the value of $\tilde{\beta}_1$.

(ii) Find $V(\tilde{\beta}_1)$

(iii) Verify that $\tilde{\beta}_1$ is unbiased. (5)

7. क) टीवी की बिक्री के लिए अनुमानित समीकरण नीचे दिया गया है:

Sales = 118.91 - 7.908 Price +1.863Advert

se = (6.35) (1.096) (0.683) $R^2 = 0.448$, n=30

जहां price टीवी की कीमत रुपये में मापा जाता है।

Sales बिक्री राजस्व है और Advert विज्ञापन व्यय है। बिक्री और विज्ञापन दोनों को हजारों रुपये में मापा जाता है।

(i) क्या मूल्य का ढलान गुणांक सांख्यिकीय रूप से 1 से भिन्न है? α=2% पर टेस्ट कीजिये।

(ii) कीमत के संबंध में बिक्री राजस्व की लोच की गणना कीजिये यदि औसत बिक्री राजस्व 300 है और औसत मूल्य 100 है?

(iii) आप कैसे परीक्षण करेंगे कि विज्ञापन व्यय में वृद्धि से बिक्री राजस्व में वृद्धि होगी जो बढ़े हुए विज्ञापन व्यय को कवर करने के लिए पर्याप्त है? रिक्त और वैकल्पिक परिकल्पनाओं को स्पष्ट रूप से बताएं। α=5% पर टेस्ट कीजिये।

(iv) 6 रुपये की कीमत और 1,200 रुपये के विज्ञापन व्यय के लिए बिक्री राजस्व का अनुमान लगाएं। (3+2+3+2)

ख) निम्नलिखित प्रतिगमन पर विचार कीजिये $Y_i = \beta_1 X_i + \mu_i$ जहां $\tilde{\beta}_1$ β_1 का OLS अनुमानक है।

(i) $\tilde{\beta}_1$ का मान ज्ञात कीजिये।

(ii) $V(\tilde{\beta}_1)$ खोजिये।

(iii) सत्यापित कीजिये कि $\tilde{\beta}_1$ निष्पक्ष है। (5)

TABLE D.1
Areas Under the Standardized Normal Distribution

Example

$Pr(0 \le Z \le 1.96) = 0.4750$

$Pr(Z \ge 1.96) = 0.5 - 0.4750 = 0.025$

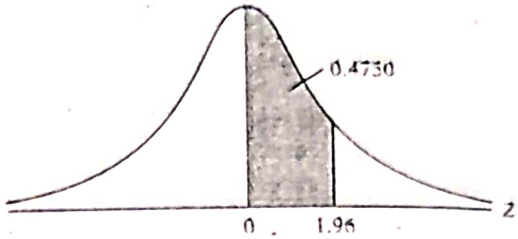

Z	.00	.01	.02	.03	.04	.05	.06	.07	.08	.09
0.0	.0000	.0040	.0080	.0120	.0160	.0199	.0239	.0279	.0319	.0359
0.1	.0398	.0438	.0478	.0517	.0557	.0596	.0636	.0675	.0714	.0753
0.2	.0793	.0832	.0871	.0910	.0948	.0987	.1026	.1064	.1103	.1141
0.3	.1179	.1217	.1255	.1293	.1331	.1368	.1406	.1443	.1480	.1517
0.4	.1554	.1591	.1628	.1664	.1700	.1736	.1772	.1808	.1844	.1879
0.5	.1915	.1950	.1985	.2019	.2054	.2088	.2123	.2157	.2190	.2224
0.6	.2257	.2291	.2324	.2357	.2389	.2422	.2454	.2486	.2517	.2549
0.7	.2580	.2611	.2642	.2673	.2704	.2734	.2764	.2794	.2823	.2852
0.8	.2881	.2910	.2939	.2967	.2995	.3023	.3051	.3078	.3106	.3133
0.9	.3159	.3186	.3212	.3238	.3264	.3289	.3315	.3340	.3365	.3389
1.0	.3413	.3438	.3461	.3485	.3508	.3531	.3554	.3577	.3599	.3621
1.1	.3643	.3665	.3686	.3708	.3729	.3749	.3770	.3790	.3810	.3830
1.2	.3849	.3869	.3888	.3907	.3925	.3944	.3962	.3980	.3997	.4015
1.3	.4032	.4049	.4066	.4082	.4099	.4115	.4131	.4147	.4162	.4177
1.4	.4192	.4207	.4222	.4236	.4251	.4265	.4279	.4292	.4306	.4319
1.5	.4332	.4345	.4357	.4370	.4382	.4394	.4406	.4418	.4429	.4441
1.6	.4452	.4463	.4474	.4484	.4495	.4505	.4515	.4525	.4535	.4545
1.7	.4454	.4564	.4573	.4582	.4591	.4599	.4608	.4616	.4625	.4633
1.8	.4641	.4649	.4656	.4664	.4671	.4678	.4686	.4693	.4699	.4706
1.9	.4713	.4719	.4726	.4732	.4738	.4744	.4750	.4756	.4761	.4767
2.0	.4772	.4778	.4783	.4788	.4793	.4798	.4803	.4808	.4812	.4817
2.1	.4821	.4826	.4830	.4834	.4838	.4842	.4846	.4850	.4854	.4857
2.2	.4861	.4864	.4868	.4871	.4875	.4878	.4881	.4884	.4887	.4890
2.3	.4893	.4896	.4898	.4901	.4904	.4906	.4909	.4911	.4913	.4916
2.4	.4918	.4920	.4922	.4925	.4927	.4929	.4931	.4932	.4934	.4936
2.5	.4938	.4940	.4941	.4943	.4945	.4946	.4948	.4949	.4951	.4952
2.6	.4953	.4955	.4956	.4957	.4959	.4960	.4961	.4962	.4963	.4964
2.7	.4965	.4966	.4967	.4968	.4969	.4970	.4971	.4972	.4973	.4974
2.8	.4974	.4975	.4976	.4977	.4977	.4978	.4979	.4979	.4980	.4981
2.9	.4981	.4982	.4982	.4983	.4984	.4984	.4985	.4985	.4986	.4986
3.0	.4987	.4987	.4987	.4988	.4988	.4989	.4989	.4989	.4990	.4990

Note: This table gives the area in the right-hand tail of the distribution (i.e., $Z \ge 0$). But since the normal distribution is symmetrical about $Z = 0$, the area in the left-hand tail is the same as the area in the corresponding right-hand tail. For example, $P(-1.96 \le Z \le 0) = 0.4750$. Therefore, $P(-1.96 \le Z \le 1.96) = 2(0.4750) = 0.95$.

TABLE D.2
Percentage Points of the t Distribution

Source: From E. S. Pearson and H. O. Hartley, eds., *Biometrika Tables for Statisticians*, vol. 1, 3d ed., table 12, Cambridge University Press, New York, 1966. Reproduced by permission of the editors and trustees of *Biometrika*.

Example

$\Pr(t > 2.086) = 0.025$

$\Pr(t > 1.725) = 0.05$ for df = 20

$\Pr(|t| > 1.725) = 0.10$

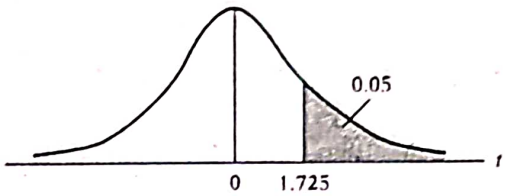

df \ Pr	0.25 0.50	0.10 0.20	0.05 0.10	0.025 0.05	0.01 0.02	0.005 0.010	0.001 0.002
1	1.000	3.078	6.314	12.706	31.821	63.657	318.31
2	0.816	1.886	2.920	4.303	6.965	9.925	22.327
3	0.765	1.638	2.353	3.182	4.541	5.841	10.214
4	0.741	1.533	2.132	2.776	3.747	4.604	7.173
5	0.727	1.476	2.015	2.571	3.365	4.032	5.893
6	0.718	1.440	1.943	2.447	3.143	3.707	5.208
7	0.711	1.415	1.895	2.365	2.998	3.499	4.785
8	0.706	1.397	1.860	2.306	2.896	3.355	4.501
9	0.703	1.383	1.833	2.262	2.821	3.250	4.297
10	0.700	1.372	1.812	2.228	2.764	3.169	4.144
11	0.697	1.363	1.796	2.201	2.718	3.106	4.025
12	0.695	1.356	1.782	2.179	2.681	3.055	3.930
13	0.694	1.350	1.771	2.160	2.650	3.012	3.852
14	0.692	1.345	1.761	2.145	2.624	2.977	3.787
15	0.691	1.341	1.753	2.131	2.602	2.947	3.733
16	0.690	1.337	1.746	2.120	2.583	2.921	3.686
17	0.689	1.333	1.740	2.110	2.567	2.898	3.646
18	0.688	1.330	1.734	2.101	2.552	2.878	3.610
19	0.688	1.328	1.729	2.093	2.539	2.861	3.579
20	0.687	1.325	1.725	2.086	2.528	2.845	3.552
21	0.686	1.323	1.721	2.080	2.518	2.831	3.527
22	0.686	1.321	1.717	2.074	2.508	2.819	3.505
23	0.685	1.319	1.714	2.069	2.500	2.807	3.485
24	0.685	1.318	1.711	2.064	2.492	2.797	3.467
25	0.684	1.316	1.708	2.060	2.485	2.787	3.450
26	0.684	1.315	1.706	2.056	2.479	2.779	3.435
27	0.684	1.314	1.703	2.052	2.473	2.771	3.421
28	0.683	1.313	1.701	2.048	2.467	2.763	3.408
29	0.683	1.311	1.699	2.045	2.462	2.756	3.396
30	0.683	1.310	1.697	2.042	2.457	2.750	3.385
40	0.681	1.303	1.684	2.021	2.423	2.704	3.307
60	0.679	1.296	1.671	2.000	2.390	2.660	3.232
120	0.677	1.289	1.658	1.980	2.358	2.617	3.160
∞	0.674	1.282	1.645	1.960	2.326	2.576	3.090

Note: The smaller probability shown at the head of each column is the area in one tail; the larger probability is the area in both tails.

TABLE D.3 Upper Percentage Points of the *F* Distribution

Example

$\Pr(F > 1.59) = 0.25$

$\Pr(F > 2.42) = 0.10$ for df $N_1 = 10$

$\Pr(F > 3.14) = 0.05$ and $N_2 = 9$

$\Pr(F > 5.26) = 0.01$

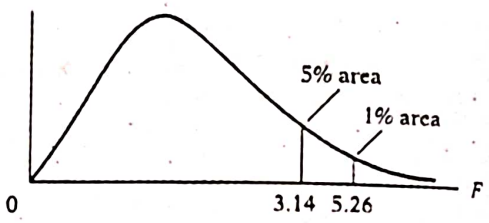

df for denominator N_2	Pr	df for numerator N_1: 1	2	3	4	5	6	7	8	9	10	11	12
1	.25	5.83	7.50	8.20	8.58	8.82	8.98	9.10	9.19	9.26	9.32	9.36	9.41
	.10	39.9	49.5	53.6	55.8	57.2	58.2	58.9	59.4	59.9	60.2	60.5	60.7
	.05	161	200	216	225	230	234	237	239	241	242	243	244
2	.25	2.57	3.00	3.15	3.23	3.28	3.31	3.34	3.35	3.37	3.38	3.39	3.39
	.10	8.53	9.00	9.16	9.24	9.29	9.33	9.35	9.37	9.38	9.39	9.40	9.41
	.05	18.5	19.0	19.2	19.2	19.3	19.3	19.4	19.4	19.4	19.4	19.4	19.4
	.01	98.5	99.0	99.2	99.2	99.3	99.3	99.4	99.4	99.4	99.4	99.4	99.4
3	.25	2.02	2.28	2.36	2.39	2.41	2.42	2.43	2.44	2.44	2.44	2.45	2.45
	.10	5.54	5.46	5.39	5.34	5.31	5.28	5.27	5.25	5.24	5.23	5.22	5.22
	.05	10.1	9.55	9.28	9.12	9.01	8.94	8.89	8.85	8.81	8.79	8.76	8.74
	.01	34.1	30.8	29.5	28.7	28.2	27.9	27.7	27.5	27.3	27.2	27.1	27.1
4	.25	1.81	2.00	2.05	2.06	2.07	2.08	2.08	2.08	2.08	2.08	2.08	2.08
	.10	4.54	4.32	4.19	4.11	4.05	4.01	3.98	3.95	3.94	3.92	3.91	3.90
	.05	7.71	6.94	6.59	6.39	6.26	6.16	6.09	6.04	6.00	5.96	5.94	5.91
	.01	21.2	18.0	16.7	16.0	15.5	15.2	15.0	14.8	14.7	14.5	14.4	14.4
5	.25	1.69	1.85	1.88	1.89	1.89	1.89	1.89	1.89	1.89	1.89	1.89	1.89
	.10	4.06	3.78	3.62	3.52	3.45	3.40	3.37	3.34	3.32	3.30	3.28	3.27
	.05	6.61	5.79	5.41	5.19	5.05	4.95	4.88	4.82	4.77	4.74	4.71	4.68
	.01	16.3	13.3	12.1	11.4	11.0	10.7	10.5	10.3	10.2	10.1	9.96	9.89
6	.25	1.62	1.76	1.78	1.79	1.79	1.78	1.78	1.78	1.77	1.77	1.77	1.77
	.10	3.78	3.46	3.29	3.18	3.11	3.05	3.01	2.98	2.96	2.94	2.92	2.90
	.05	5.99	5.14	4.76	4.53	4.39	4.28	4.21	4.15	4.10	4.06	4.03	4.00
	.01	13.7	10.9	9.78	9.15	8.75	8.47	8.26	8.10	7.98	7.87	7.79	7.72
7	.25	1.57	1.70	1.72	1.72	1.71	1.71	1.70	1.70	1.69	1.69	1.69	1.68
	.10	3.59	3.26	3.07	2.96	2.88	2.83	2.78	2.75	2.72	2.70	2.68	2.67
	.05	5.59	4.74	4.35	4.12	3.97	3.87	3.79	3.73	3.68	3.64	3.60	3.57
	.01	12.2	9.55	8.45	7.85	7.46	7.19	6.99	6.84	6.72	6.62	6.54	6.47
8	.25	1.54	1.66	1.67	1.66	1.66	1.65	1.64	1.64	1.63	1.63	1.63	1.62
	.10	3.46	3.11	2.92	2.81	2.73	2.67	2.62	2.59	2.56	2.54	2.52	2.50
	.05	5.32	4.46	4.07	3.84	3.69	3.58	3.50	3.44	3.39	3.35	3.31	3.28
	.01	11.3	8.65	7.59	7.01	6.63	6.37	6.18	6.03	5.91	5.81	5.73	5.67
9	.25	1.51	1.62	1.63	1.63	1.62	1.61	1.60	1.60	1.59	1.59	1.58	1.58
	.10	3.36	3.01	2.81	2.69	2.61	2.55	2.51	2.47	2.44	2.42	2.40	2.38
	.05	5.12	4.26	3.86	3.63	3.48	3.37	3.29	3.23	3.18	3.14	3.10	3.07
	.01	10.6	8.02	6.99	6.42	6.06	5.80	5.61	5.47	5.35	5.26	5.18	5.11

Source: From E. S. Pearson and H. O. Hartley, eds., *Biometrika Tables for Statisticians*, vol. 1, 3d ed., table 18, Cambridge University Press, New York, 1966. Reproduced by permission of the editors and trustees of *Biometrika*.

df for numerator N_1													df for denominator N_2
15	20	24	30	40	50	60	100	120	200	500	∞	Pr	
9.49	9.58	9.63	9.67	9.71	9.74	9.76	9.78	9.80	9.82	9.84	9.85	.25	
61.2	61.7	62.0	62.3	62.5	62.7	62.8	63.0	63.1	63.2	63.3	63.3	.10	1
246	248	249	250	251	252	252	253	253	254	254	254	.05	
3.41	3.43	3.43	3.44	3.45	3.45	3.46	3.47	3.47	3.48	3.48	3.48	.25	
9.42	9.44	9.45	9.46	9.47	9.47	9.47	9.48	9.48	9.49	9.49	9.49	.10	
19.4	19.4	19.5	19.5	19.5	19.5	19.5	19.5	19.5	19.5	19.5	19.5	.05	2
99.4	99.4	99.5	99.5	99.5	99.5	99.5	99.5	99.5	99.5	99.5	99.5	.01	
2.46	2.46	2.46	2.47	2.47	2.47	2.47	2.47	2.47	2.47	2.47	2.47	.25	
5.20	5.18	5.18	5.17	5.16	5.15	5.15	5.14	5.14	5.14	5.14	5.13	.10	
8.70	8.66	8.64	8.62	8.59	8.58	8.57	8.55	8.55	8.54	8.53	8.53	.05	3
26.9	26.7	26.6	26.5	26.4	26.4	26.3	26.2	26.2	26.2	26.1	26.1	.01	
2.08	2.08	2.08	2.08	2.08	2.08	2.08	2.08	2.08	2.08	2.08	2.08	.25	
3.87	3.84	3.83	3.82	3.80	3.80	3.79	3.78	3.78	3.77	3.76	3.76	.10	
5.86	5.80	5.77	5.75	5.72	5.70	5.69	5.66	5.66	5.65	5.64	5.63	.05	4
14.2	14.0	13.9	13.8	13.7	13.7	13.7	13.6	13.6	13.5	13.5	13.5	.01	
1.89	1.88	1.88	1.88	1.88	1.88	1.87	1.87	1.87	1.87	1.87	1.87	.25	
3.24	3.21	3.19	3.17	3.16	3.15	3.14	3.13	3.12	3.12	3.11	3.10	.10	
4.62	4.56	4.53	4.50	4.46	4.44	4.43	4.41	4.40	4.39	4.37	4.36	.05	5
9.72	9.55	9.47	9.38	9.29	9.24	9.20	9.13	9.11	9.08	9.04	9.02	.01	
1.76	1.76	1.75	1.75	1.75	1.75	1.74	1.74	1.74	1.74	1.74	1.74	.25	
2.87	2.84	2.82	2.80	2.78	2.77	2.76	2.75	2.74	2.73	2.73	2.72	.10	
3.94	3.87	3.84	3.81	3.77	3.75	3.74	3.71	3.70	3.69	3.68	3.67	.05	6
7.56	7.40	7.31	7.23	7.14	7.09	7.06	6.99	6.97	6.93	6.90	6.88	.01	
1.68	1.67	1.67	1.66	1.66	1.66	1.65	1.65	1.65	1.65	1.65	1.65	.25	
2.63	2.59	2.58	2.56	2.54	2.52	2.51	2.50	2.49	2.48	2.48	2.47	.10	
3.51	3.44	3.41	3.38	3.34	3.32	3.30	3.27	3.27	3.25	3.24	3.23	.05	7
6.31	6.16	6.07	5.99	5.91	5.86	5.82	5.75	5.74	5.70	5.67	5.65	.01	
1.62	1.61	1.60	1.60	1.59	1.59	1.59	1.58	1.58	1.58	1.58	1.58	.25	
2.46	2.42	2.40	2.38	2.36	2.35	2.34	2.32	2.32	2.31	2.30	2.29	.10	
3.22	3.15	3.12	3.08	3.04	2.02	3.01	2.97	2.97	2.95	2.94	2.93	.05	8
5.52	5.36	5.28	5.20	5.12	5.07	5.03	4.96	4.95	4.91	4.88	4.86	.01	
1.57	1.56	1.56	1.55	1.55	1.54	1.54	1.53	1.53	1.53	1.53	1.53	.25	
2.34	2.30	2.28	2.25	2.23	2.22	2.21	2.19	2.18	2.17	2.17	2.16	.10	
3.01	2.94	2.90	2.86	2.83	2.80	2.79	2.76	2.75	2.73	2.72	2.71	.05	9
4.96	4.81	4.73	4.65	4.57	4.52	4.48	4.42	4.40	4.36	4.33	4.31	.01	

(Continued)

TABLE D.3 Upper Percentage Points of the *F* Distribution *(Continued)*

df for denominator N_2	Pr	df for numerator N_1: 1	2	3	4	5	6	7	8	9	10	11	12
10	.25	1.49	1.60	1.60	1.59	1.59	1.58	1.57	1.56	1.56	1.55	1.55	1.54
	.10	3.29	2.92	2.73	2.61	2.52	2.46	2.41	2.38	2.35	2.32	2.30	2.28
	.05	4.96	4.10	3.71	3.48	3.33	3.22	3.14	3.07	3.02	2.98	2.94	2.91
	.01	10.0	7.56	6.55	5.99	5.64	5.39	5.20	5.06	4.94	4.85	4.77	4.71
11	.25	1.47	1.58	1.58	1.57	1.56	1.55	1.54	1.53	1.53	1.52	1.52	1.51
	.10	3.23	2.86	2.66	2.54	2.45	2.39	2.34	2.30	2.27	2.25	2.23	2.21
	.05	4.84	3.98	3.59	3.36	3.20	3.09	3.01	2.95	2.90	2.85	2.82	2.79
	.01	9.65	7.21	6.22	5.67	5.32	5.07	4.89	4.74	4.63	4.54	4.46	4.40
12	.25	1.46	1.56	1.56	1.55	1.54	1.53	1.52	1.51	1.51	1.50	1.50	1.49
	.10	3.18	2.81	2.61	2.48	2.39	2.33	2.28	2.24	2.21	2.19	2.17	2.15
	.05	4.75	3.89	3.49	3.26	3.11	3.00	2.91	2.85	2.80	2.75	2.72	2.69
	.01	9.33	6.93	5.95	5.41	5.06	4.82	4.64	4.50	4.39	4.30	4.22	4.16
13	.25	1.45	1.55	1.55	1.53	1.52	1.51	1.50	1.49	1.49	1.48	1.47	1.47
	.10	3.14	2.76	2.56	2.43	2.35	2.28	2.23	2.20	2.16	2.14	2.12	2.10
	.05	4.67	3.81	3.41	3.18	3.03	2.92	2.83	2.77	2.71	2.67	2.63	2.60
	.01	9.07	6.70	5.74	5.21	4.86	4.62	4.44	4.30	4.19	4.10	4.02	3.96
14	.25	1.44	1.53	1.53	1.52	1.51	1.50	1.49	1.48	1.47	1.46	1.46	1.45
	.10	3.10	2.73	2.52	2.39	2.31	2.24	2.19	2.15	2.12	2.10	2.08	2.05
	.05	4.60	3.74	3.34	3.11	2.96	2.85	2.76	2.70	2.65	2.60	2.57	2.53
	.01	8.86	6.51	5.56	5.04	4.69	4.46	4.28	4.14	4.03	3.94	3.86	3.80
15	.25	1.43	1.52	1.52	1.51	1.49	1.48	1.47	1.46	1.46	1.45	1.44	1.44
	.10	3.07	2.70	2.49	2.36	2.27	2.21	2.16	2.12	2.09	2.06	2.04	2.02
	.05	4.54	3.68	3.29	3.06	2.90	2.79	2.71	2.64	2.59	2.54	2.51	2.48
	.01	8.68	6.36	5.42	4.89	4.56	4.32	4.14	4.00	3.89	3.80	3.73	3.67
16	.25	1.42	1.51	1.51	1.50	1.48	1.47	1.46	1.45	1.44	1.44	1.44	1.43
	.10	3.05	2.67	2.46	2.33	2.24	2.18	2.13	2.09	2.06	2.03	2.01	1.99
	.05	4.49	3.63	3.24	3.01	2.85	2.74	2.66	2.59	2.54	2.49	2.46	2.42
	.01	8.53	6.23	5.29	4.77	4.44	4.20	4.03	3.89	3.78	3.69	3.62	3.55
17	.25	1.42	1.51	1.50	1.49	1.47	1.46	1.45	1.44	1.43	1.43	1.42	1.41
	.10	3.03	2.64	2.44	2.31	2.22	2.15	2.10	2.06	2.03	2.00	1.98	1.96
	.05	4.45	3.59	3.20	2.96	2.81	2.70	2.61	2.55	2.49	2.45	2.41	2.38
	.01	8.40	6.11	5.18	4.67	4.34	4.10	3.93	3.79	3.68	3.59	3.52	3.46
18	.25	1.41	1.50	1.49	1.48	1.46	1.45	1.44	1.43	1.42	1.42	1.41	1.40
	.10	3.01	2.62	2.42	2.29	2.20	2.13	2.08	2.04	2.00	1.98	1.96	1.93
	.05	4.41	3.55	3.16	2.93	2.77	2.66	2.58	2.51	2.46	2.41	2.37	2.34
	.01	8.29	6.01	5.09	4.58	4.25	4.01	3.84	3.71	3.60	3.51	3.43	3.37
19	.25	1.41	1.49	1.49	1.47	1.46	1.44	1.43	1.42	1.41	1.41	1.40	1.40
	.10	2.99	2.61	2.40	2.27	2.18	2.11	2.06	2.02	1.98	1.96	1.94	1.91
	.05	4.38	3.52	3.13	2.90	2.74	2.63	2.54	2.48	2.42	2.38	2.34	2.31
	.01	8.18	5.93	5.01	4.50	4.17	3.94	3.77	3.63	3.52	3.43	3.36	3.30
20	.25	1.40	1.49	1.48	1.46	1.45	1.44	1.43	1.42	1.41	1.40	1.39	1.39
	.10	2.97	2.59	2.38	2.25	2.16	2.09	2.04	2.00	1.96	1.94	1.92	1.89
	.05	4.35	3.49	3.10	2.87	2.71	2.60	2.51	2.45	2.39	2.35	2.31	2.28
	.01	8.10	5.85	4.94	4.43	4.10	3.87	3.70	3.56	3.46	3.37	3.29	3.23

df for numerator N_1													df for denominator N_2
15	20	24	30	40	50	60	100	120	200	500	∞	Pr	
1.53	1.52	1.52	1.51	1.51	1.50	1.50	1.49	1.49	1.49	1.48	1.48	.25	10
2.24	2.20	2.18	2.16	2.13	2.12	2.11	2.09	2.08	2.07	2.06	2.06	.10	
2.85	2.77	2.74	2.70	2.66	2.64	2.62	2.59	2.58	2.56	2.55	2.54	.05	
4.56	4.41	4.33	4.25	4.17	4.12	4.08	4.01	4.00	3.96	3.93	3.91	.01	
1.50	1.49	1.49	1.48	1.47	1.47	1.47	1.46	1.46	1.46	1.45	1.45	.25	11
2.17	2.12	2.10	2.08	2.05	2.04	2.03	2.00	2.00	1.99	1.98	1.97	.10	
2.72	2.65	2.61	2.57	2.53	2.51	2.49	2.46	2.45	2.43	2.42	2.40	.05	
4.25	4.10	4.02	3.94	3.86	3.81	3.78	3.71	3.69	3.66	3.62	3.60	.01	
1.48	1.47	1.46	1.45	1.45	1.44	1.44	1.43	1.43	1.43	1.42	1.42	.25	12
2.10	2.06	2.04	2.01	1.99	1.97	1.96	1.94	1.93	1.92	1.91	1.90	.10	
2.62	2.54	2.51	2.47	2.43	2.40	2.38	2.35	2.34	2.32	2.31	2.30	.05	
4.01	3.86	3.78	3.70	3.62	3.57	3.54	3.47	3.45	3.41	3.38	3.36	.01	
1.46	1.45	1.44	1.43	1.42	1.42	1.42	1.41	1.41	1.40	1.40	1.40	.25	13
2.05	2.01	1.98	1.96	1.93	1.92	1.90	1.88	1.88	1.86	1.85	1.85	.10	
2.53	2.46	2.42	2.38	2.34	2.31	2.30	2.26	2.25	2.23	2.22	2.21	.05	
3.82	3.66	3.59	3.51	3.43	3.38	3.34	3.27	3.25	3.22	3.19	3.17	.01	
1.44	1.43	1.42	1.41	1.41	1.40	1.40	1.39	1.39	1.39	1.38	1.38	.25	14
2.01	1.96	1.94	1.91	1.89	1.87	1.86	1.83	1.83	1.82	1.80	1.80	.10	
2.46	2.39	2.35	2.31	2.27	2.24	2.22	2.19	2.18	2.16	2.14	2.13	.05	
3.66	3.51	3.43	3.35	3.27	3.22	3.18	3.11	3.09	3.06	3.03	3.00	.01	
1.43	1.41	1.41	1.40	1.39	1.39	1.38	1.38	1.37	1.37	1.36	1.36	.25	15
1.97	1.92	1.90	1.87	1.85	1.83	1.82	1.79	1.79	1.77	1.76	1.76	.10	
2.40	2.33	2.29	2.25	2.20	2.18	2.16	2.12	2.11	2.10	2.08	2.07	.05	
3.52	3.37	3.29	3.21	3.13	3.08	3.05	2.98	2.96	2.92	2.89	2.87	.01	
1.41	1.40	1.39	1.38	1.37	1.37	1.36	1.36	1.35	1.35	1.34	1.34	.25	16
1.94	1.89	1.87	1.84	1.81	1.79	1.78	1.76	1.75	1.74	1.73	1.72	.10	
2.35	2.28	2.24	2.19	2.15	2.12	2.11	2.07	2.06	2.04	2.02	2.01	.05	
3.41	3.26	3.18	3.10	3.02	2.97	2.93	2.86	2.84	2.81	2.78	2.75	.01	
1.40	1.39	1.38	1.37	1.36	1.35	1.35	1.34	1.34	1.34	1.33	1.33	.25	17
1.91	1.86	1.84	1.81	1.78	1.76	1.75	1.73	1.72	1.71	1.69	1.69	.10	
2.31	2.23	2.19	2.15	2.10	2.08	2.06	2.02	2.01	1.99	1.97	1.96	.05	
3.31	3.16	3.08	3.00	2.92	2.87	2.83	2.76	2.75	2.71	2.68	2.65	.01	
1.39	1.38	1.37	1.36	1.35	1.34	1.34	1.33	1.33	1.32	1.32	1.32	.25	18
1.89	1.84	1.81	1.78	1.75	1.74	1.72	1.70	1.69	1.68	1.67	1.66	.10	
2.27	2.19	2.15	2.11	2.06	2.04	2.02	1.98	1.97	1.95	1.93	1.92	.05	
3.23	3.08	3.00	2.92	2.84	2.78	2.75	2.68	2.66	2.62	2.59	2.57	.01	
1.38	1.37	1.36	1.35	1.34	1.33	1.33	1.32	1.32	1.31	1.31	1.30	.25	19
1.86	1.81	1.79	1.76	1.73	1.71	1.70	1.67	1.67	1.65	1.64	1.63	.10	
2.23	2.16	2.11	2.07	2.03	2.00	1.98	1.94	1.93	1.91	1.89	1.88	.05	
3.15	3.00	2.92	2.84	2.76	2.71	2.67	2.60	2.58	2.55	2.51	2.49	.01	
1.37	1.36	1.35	1.34	1.33	1.33	1.32	1.31	1.31	1.30	1.30	1.29	.25	20
1.84	1.79	1.77	1.74	1.71	1.69	1.68	1.65	1.64	1.63	1.62	1.61	.10	
2.20	2.12	2.08	2.04	1.99	1.97	1.95	1.91	1.90	1.88	1.86	1.84	.05	
3.09	2.94	2.86	2.78	2.69	2.64	2.61	2.54	2.52	2.48	2.44	2.42	.01	

(Continued)

TABLE D.3 Upper Percentage Points of the *F* Distribution (*Continued*)

df for denominator N_2	Pr	df for numerator N_1: 1	2	3	4	5	6	7	8	9	10	11	12
22	.25	1.40	1.48	1.47	1.45	1.44	1.42	1.41	1.40	1.39	1.39	1.38	1.37
	.10	2.95	2.56	2.35	2.22	2.13	2.06	2.01	1.97	1.93	1.90	1.88	1.86
	.05	4.30	3.44	3.05	2.82	2.66	2.55	2.46	2.40	2.34	2.30	2.26	2.23
	.01	7.95	5.72	4.82	4.31	3.99	3.76	3.59	3.45	3.35	3.26	3.18	3.12
24	.25	1.39	1.47	1.46	1.44	1.43	1.41	1.40	1.39	1.38	1.38	1.37	1.36
	.10	2.93	2.54	2.33	2.19	2.10	2.04	1.98	1.94	1.91	1.88	1.85	1.83
	.05	4.26	3.40	3.01	2.78	2.62	2.51	2.42	2.36	2.30	2.25	2.21	2.18
	.01	7.82	5.61	4.72	4.22	3.90	3.67	3.50	3.36	3.26	3.17	3.09	3.03
26	.25	1.38	1.46	1.45	1.44	1.42	1.41	1.39	1.38	1.37	1.37	1.36	1.35
	.10	2.91	2.52	2.31	2.17	2.08	2.01	1.96	1.92	1.88	1.86	1.84	1.81
	.05	4.23	3.37	2.98	2.74	2.59	2.47	2.39	2.32	2.27	2.22	2.18	2.15
	.01	7.72	5.53	4.64	4.14	3.82	3.59	3.42	3.29	3.18	3.09	3.02	2.96
28	.25	1.38	1.46	1.45	1.43	1.41	1.40	1.39	1.38	1.37	1.36	1.35	1.34
	.10	2.89	2.50	2.29	2.16	2.06	2.00	1.94	1.90	1.87	1.84	1.81	1.79
	.05	4.20	3.34	2.95	2.71	2.56	2.45	2.36	2.29	2.24	2.19	2.15	2.12
	.01	7.64	5.45	4.57	4.07	3.75	3.53	3.36	3.23	3.12	3.03	2.96	2.90
30	.25	1.38	1.45	1.44	1.42	1.41	1.39	1.38	1.37	1.36	1.35	1.35	1.34
	.10	2.88	2.49	2.28	2.14	2.05	1.98	1.93	1.88	1.85	1.82	1.79	1.77
	.05	4.17	3.32	2.92	2.69	2.53	2.42	2.33	2.27	2.21	2.16	2.13	2.09
	.01	7.56	5.39	4.51	4.02	3.70	3.47	3.30	3.17	3.07	2.98	2.91	2.84
40	.25	1.36	1.44	1.42	1.40	1.39	1.37	1.36	1.35	1.34	1.33	1.32	1.31
	.10	2.84	2.44	2.23	2.09	2.00	1.93	1.87	1.83	1.79	1.76	1.73	1.71
	.05	4.08	3.23	2.84	2.61	2.45	2.34	2.25	2.18	2.12	2.08	2.04	2.00
	.01	7.31	5.18	4.31	3.83	3.51	3.29	3.12	2.99	2.89	2.80	2.73	2.66
60	.25	1.35	1.42	1.41	1.38	1.37	1.35	1.33	1.32	1.31	1.30	1.29	1.29
	.10	2.79	2.39	2.18	2.04	1.95	1.87	1.82	1.77	1.74	1.71	1.68	1.66
	.05	4.00	3.15	2.76	2.53	2.37	2.25	2.17	2.10	2.04	1.99	1.95	1.92
	.01	7.08	4.98	4.13	3.65	3.34	3.12	2.95	2.82	2.72	2.63	2.56	2.50
120	.25	1.34	1.40	1.39	1.37	1.35	1.33	1.31	1.30	1.29	1.28	1.27	1.26
	.10	2.75	2.35	2.13	1.99	1.90	1.82	1.77	1.72	1.68	1.65	1.62	1.60
	.05	3.92	3.07	2.68	2.45	2.29	2.17	2.09	2.02	1.96	1.91	1.87	1.83
	.01	6.85	4.79	3.95	3.48	3.17	2.96	2.79	2.66	2.56	2.47	2.40	2.34
200	.25	1.33	1.39	1.38	1.36	1.34	1.32	1.31	1.29	1.28	1.27	1.26	1.25
	.10	2.73	2.33	2.11	1.97	1.88	1.80	1.75	1.70	1.66	1.63	1.60	1.57
	.05	3.89	3.04	2.65	2.42	2.26	2.14	2.06	1.98	1.93	1.88	1.84	1.80
	.01	6.76	4.71	3.88	3.41	3.11	2.89	2.73	2.60	2.50	2.41	2.34	2.27
∞	.25	1.32	1.39	1.37	1.35	1.33	1.31	1.29	1.28	1.27	1.25	1.24	1.24
	.10	2.71	2.30	2.08	1.94	1.85	1.77	1.72	1.67	1.63	1.60	1.57	1.55
	.05	3.84	3.00	2.60	2.37	2.21	2.10	2.01	1.94	1.88	1.83	1.79	1.75
	.01	6.63	4.61	3.78	3.32	3.02	2.80	2.64	2.51	2.41	2.32	2.25	2.18

df for numerator N_1													df for denominator N_2
15	20	24	30	40	50	60	100	120	200	500	∞	Pr	
1.36	1.34	1.33	1.32	1.31	1.31	1.30	1.30	1.30	1.29	1.29	1.28	.25	22
1.81	1.76	1.73	1.70	1.67	1.65	1.64	1.61	1.60	1.59	1.58	1.57	.10	
2.15	2.07	2.03	1.98	1.94	1.91	1.89	1.85	1.84	1.82	1.80	1.78	.05	
2.98	2.83	2.75	2.67	2.58	2.53	2.50	2.42	2.40	2.36	2.33	2.31	.01	
1.35	1.33	1.32	1.31	1.30	1.29	1.29	1.28	1.28	1.27	1.27	1.26	.25	24
1.78	1.73	1.70	1.67	1.64	1.62	1.61	1.58	1.57	1.56	1.54	1.53	.10	
2.11	2.03	1.98	1.94	1.89	1.86	1.84	1.80	1.79	1.77	1.75	1.73	.05	
2.89	2.74	2.66	2.58	2.49	2.44	2.40	2.33	2.31	2.27	2.24	2.21	.01	
1.34	1.32	1.31	1.30	1.29	1.28	1.28	1.26	1.26	1.26	1.25	1.25	.25	26
1.76	1.71	1.68	1.65	1.61	1.59	1.58	1.55	1.54	1.53	1.51	1.50	.10	
2.07	1.99	1.95	1.90	1.85	1.82	1.80	1.76	1.75	1.73	1.71	1.69	.05	
2.81	2.66	2.58	2.50	2.42	2.36	2.33	2.25	2.23	2.19	2.16	2.13	.01	
1.33	1.31	1.30	1.29	1.28	1.27	1.27	1.26	1.25	1.25	1.24	1.24	.25	28
1.74	1.69	1.66	1.63	1.59	1.57	1.56	1.53	1.52	1.50	1.49	1.48	.10	
2.04	1.96	1.91	1.87	1.82	1.79	1.77	1.73	1.71	1.69	1.67	1.65	.05	
2.75	2.60	2.52	2.44	2.35	2.30	2.26	2.19	2.17	2.13	2.09	2.06	.01	
1.32	1.30	1.29	1.28	1.27	1.26	1.26	1.25	1.24	1.24	1.23	1.23	.25	30
1.72	1.67	1.64	1.61	1.57	1.55	1.54	1.51	1.50	1.48	1.47	1.46	.10	
2.01	1.93	1.89	1.84	1.79	1.76	1.74	1.70	1.68	1.66	1.64	1.62	.05	
2.70	2.55	2.47	2.39	2.30	2.25	2.21	2.13	2.11	2.07	2.03	2.01	.01	
1.30	1.28	1.26	1.25	1.24	1.23	1.22	1.21	1.21	1.20	1.19	1.19	.25	40
1.66	1.61	1.57	1.54	1.51	1.48	1.47	1.43	1.42	1.41	1.39	1.38	.10	
1.92	1.84	1.79	1.74	1.69	1.66	1.64	1.59	1.58	1.55	1.53	1.51	.05	
2.52	2.37	2.29	2.20	2.11	2.06	2.02	1.94	1.92	1.87	1.83	1.80	.01	
1.27	1.25	1.24	1.22	1.21	1.20	1.19	1.17	1.17	1.16	1.15	1.15	.25	60
1.60	1.54	1.51	1.48	1.44	1.41	1.40	1.36	1.35	1.33	1.31	1.29	.10	
1.84	1.75	1.70	1.65	1.59	1.56	1.53	1.48	1.47	1.44	1.41	1.39	.05	
2.35	2.20	2.12	2.03	1.94	1.88	1.84	1.75	1.73	1.68	1.63	1.60	.01	
1.24	1.22	1.21	1.19	1.18	1.17	1.16	1.14	1.13	1.12	1.11	1.10	.25	120
1.55	1.48	1.45	1.41	1.37	1.34	1.32	1.27	1.26	1.24	1.21	1.19	.10	
1.75	1.66	1.61	1.55	1.50	1.46	1.43	1.37	1.35	1.32	1.28	1.25	.05	
2.19	2.03	1.95	1.86	1.76	1.70	1.66	1.56	1.53	1.48	1.42	1.38	.01	
1.23	1.21	1.20	1.18	1.16	1.14	1.12	1.11	1.10	1.09	1.08	1.06	.25	200
1.52	1.46	1.42	1.38	1.34	1.31	1.28	1.24	1.22	1.20	1.17	1.14	.10	
1.72	1.62	1.57	1.52	1.46	1.41	1.39	1.32	1.29	1.26	1.22	1.19	.05	
2.13	1.97	1.89	1.79	1.69	1.63	1.58	1.48	1.44	1.39	1.33	1.28	.01	
1.22	1.19	1.18	1.16	1.14	1.13	1.12	1.09	1.08	1.07	1.04	1.00	.25	∞
1.49	1.42	1.38	1.34	1.30	1.26	1.24	1.18	1.17	1.13	1.08	1.00	.10	
1.67	1.57	1.52	1.46	1.39	1.35	1.32	1.24	1.22	1.17	1.11	1.00	.05	
2.04	1.88	1.79	1.70	1.59	1.52	1.47	1.36	1.32	1.25	1.15	1.00	.01	

TABLE D.4
Upper Percentage Points of the χ^2 Distribution

Example

$\Pr(\chi^2 > 10.85) = 0.95$

$\Pr(\chi^2 > 23.83) = 0.25$ for df = 20

$\Pr(\chi^2 > 31.41) = 0.05$

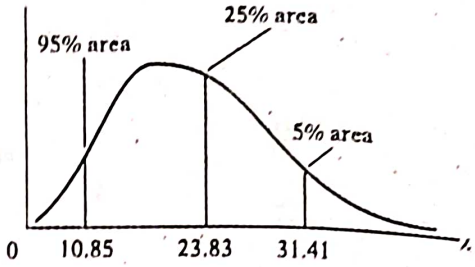

Degrees of freedom \ Pr	.995	.990	.975	.950	.900
1	392704×10^{-10}	157088×10^{-9}	982069×10^{-9}	393214×10^{-8}	.0157908
2	.0100251	.0201007	.0506356	.102587	.210720
3	.0717212	.114832	.215795	.351846	.584375
4	.206990	.297110	.484419	.710721	1.063623
5	.411740	.554300	.831211	1.145476	1.61031
6	.675727	.872085	1.237347	1.63539	2.20413
7	.989265	1.239043	1.68987	2.16735	2.83311
8	1.344419	1.646482	2.17973	2.73264	3.48954
9	1.734926	2.087912	2.70039	3.32511	4.16816
10	2.15585	2.55821	3.24697	3.94030	4.86518
11	2.60321	3.05347	3.81575	4.57481	5.57779
12	3.07382	3.57056	4.40379	5.22603	6.30380
13	3.56503	4.10691	5.00874	5.89186	7.04150
14	4.07468	4.66043	5.62872	6.57063	7.78953
15	4.60094	5.22935	6.26214	7.26094	8.54675
16	5.14224	5.81221	6.90766	7.96164	9.31223
17	5.69724	6.40776	7.56418	8.67176	10.0852
18	6.26481	7.01491	8.23075	9.39046	10.8649
19	6.84398	7.63273	8.90655	10.1170	11.6509
20	7.43386	8.26040	9.59083	10.8508	12.4426
21	8.03366	8.89720	10.28293	11.5913	13.2396
22	8.64272	9.54249	10.9823	12.3380	14.0415
23	9.26042	10.19567	11.6885	13.0905	14.8479
24	9.88623	10.8564	12.4011	13.8484	15.6587
25	10.5197	11.5240	13.1197	14.6114	16.4734
26	11.1603	12.1981	13.8439	15.3791	17.2919
27	11.8076	12.8786	14.5733	16.1513	18.1138
28	12.4613	13.5648	15.3079	16.9279	18.9392
29	13.1211	14.2565	16.0471	17.7083	19.7677
30	13.7867	14.9535	16.7908	18.4926	20.5992
40	20.7065	22.1643	24.4331	26.5093	29.0505
50	27.9907	29.7067	32.3574	34.7642	37.6886
60	35.5346	37.4848	40.4817	43.1879	46.4589
70	43.2752	45.4418	48.7576	51.7393	55.3290
80	51.1720	53.5400	57.1532	60.3915	64.2778
90	59.1963	61.7541	65.6466	69.1260	73.2912
100*	67.3276	70.0648	74.2219	77.9295	82.3581

*For df greater than 100 the expression $\sqrt{2\chi^2} - \sqrt{(2k-1)} = Z$ follows the standardized normal distribution, where k represents the degrees of freedom.

.750	.500	.250	.100	.050	.025	.010	.005
.1015308	.454937	1.32330	2.70554	3.84146	5.02389	6.63490	7.87944
.575364	1.38629	2.77259	4.60517	5.99147	7.37776	9.21034	10.5966
1.212534	2.36597	4.10835	6.25139	7.81473	9.34840	11.3449	12.8381
1.92255	3.35670	5.38527	7.77944	9.48773	11.1433	13.2767	14.8602
2.67460	4.35146	6.62568	9.23635	11.0705	12.8325	15.0863	16.7496
3.45460	5.34812	7.84080	10.6446	12.5916	14.4494	16.8119	18.5476
4.25485	6.34581	9.03715	12.0170	14.0671	16.0128	18.4753	20.2777
5.07064	7.34412	10.2188	13.3616	15.5073	17.5346	20.0902	21.9550
5.89883	8.34283	11.3887	14.6837	16.9190	19.0228	21.6660	23.5893
6.73720	9.34182	12.5489	15.9871	18.3070	20.4831	23.2093	25.1882
7.58412	10.3410	13.7007	17.2750	19.6751	21.9200	24.7250	26.7569
8.43842	11.3403	14.8454	18.5494	21.0261	23.3367	26.2170	28.2995
9.29906	12.3398	15.9839	19.8119	22.3621	24.7356	27.6883	29.8194
10.1653	13.3393	17.1170	21.0642	23.6848	26.1190	29.1413	31.3193
11.0365	14.3389	18.2451	22.3072	24.9958	27.4884	30.5779	32.8013
11.9122	15.3385	19.3688	23.5418	26.2962	28.8454	31.9999	34.2672
12.7919	16.3381	20.4887	24.7690	27.5871	30.1910	33.4087	35.7185
13.6753	17.3379	21.6049	25.9894	28.8693	31.5264	34.8053	37.1564
14.5620	18.3376	22.7178	27.2036	30.1435	32.8523	36.1908	38.5822
15.4518	19.3374	23.8277	28.4120	31.4104	34.1696	37.5662	39.9968
16.3444	20.3372	24.9348	29.6151	32.6705	35.4789	38.9321	41.4010
17.2396	21.3370	26.0393	30.8133	33.9244	36.7807	40.2894	42.7956
18.1373	22.3369	27.1413	32.0069	35.1725	38.0757	41.6384	44.1813
19.0372	23.3367	28.2412	33.1963	36.4151	39.3641	42.9798	45.5585
19.9393	24.3366	29.3389	34.3816	37.6525	40.6465	44.3141	46.9278
20.8434	25.3364	30.4345	35.5631	38.8852	41.9232	45.6417	48.2899
21.7494	26.3363	31.5284	36.7412	40.1133	43.1944	46.9630	49.6449
22.6572	27.3363	32.6205	37.9159	41.3372	44.4607	48.2782	50.9933
23.5666	28.3362	33.7109	39.0875	42.5569	45.7222	49.5879	52.3356
24.4776	29.3360	34.7998	40.2560	43.7729	46.9792	50.8922	53.6720
33.6603	39.3354	45.6160	51.8050	55.7585	59.3417	63.6907	66.7659
42.9421	49.3349	56.3336	63.1671	67.5048	71.4202	76.1539	79.4900
52.2938	59.3347	66.9814	74.3970	79.0819	83.2976	88.3794	91.9517
61.6983	69.3344	77.5766	85.5271	90.5312	95.0231	100.425	104.215
71.1445	79.3343	88.1303	96.5782	101.879	106.629	112.329	116.321
80.6247	89.3342	98.6499	107.565	113.145	118.136	124.116	128.299
90.1332	99.3341	109.141	118.498	124.342	129.561	135.807	140.169

Source: Abridged from E. S. Pearson and H. O. Hartley, eds., *Biometrika Tables for Statisticians*, vol. 1, 3d ed., table 8, Cambridge University Press, New York, 1966. Reproduced by permission of the editors and trustees of *Biometrika*.

TABLE D.5A Durbin–Watson *d* Statistic: Significance Points of d_L and d_U at 0.05 Level of Significance

	$k'=1$		$k'=2$		$k'=3$		$k'=4$		$k'=5$		$k'=6$		$k'=7$		$k'=8$		$k'=9$		$k'=10$	
n	d_L	d_U	d_L	d_U	d_L	d_U	d_L	d_U	d_L	d_U	d_L	d_U	d_L	d_U	d_L	d_U	d_L	d_U	d_L	d_U
6	0.610	1.400	—	—	—	—	—	—	—	—	—	—	—	—	—	—	—	—	—	—
7	0.700	1.356	0.467	1.896	—	—	—	—	—	—	—	—	—	—	—	—	—	—	—	—
8	0.763	1.332	0.559	1.777	0.368	2.287	—	—	—	—	—	—	—	—	—	—	—	—	—	—
9	0.824	1.320	0.629	1.699	0.455	2.128	0.296	2.588	—	—	—	—	—	—	—	—	—	—	—	—
10	0.879	1.320	0.697	1.641	0.525	2.016	0.376	2.414	0.243	2.822	—	—	—	—	—	—	—	—	—	—
11	0.927	1.324	0.658	1.604	0.595	1.928	0.444	2.283	0.316	2.645	0.203	3.005	—	—	—	—	—	—	—	—
12	0.971	1.331	0.812	1.579	0.658	1.864	0.512	2.177	0.379	2.506	0.268	2.832	0.171	3.149	—	—	—	—	—	—
13	1.010	1.340	0.861	1.562	0.715	1.816	0.574	2.094	0.445	2.390	0.328	2.692	0.230	2.985	0.147	3.266	—	—	—	—
14	1.045	1.350	0.905	1.551	0.767	1.779	0.632	2.030	0.505	2.296	0.389	2.572	0.286	2.848	0.200	3.111	0.127	3.360	—	—
15	1.077	1.361	0.946	1.543	0.814	1.750	0.685	1.977	0.562	2.220	0.447	2.472	0.343	2.727	0.261	2.979	0.175	3.216	0.111	3.438
16	1.106	1.371	0.982	1.539	0.857	1.728	0.734	1.935	0.615	2.157	0.502	2.388	0.398	2.624	0.304	2.860	0.222	3.090	0.155	3.304
17	1.133	1.381	1.015	1.536	0.897	1.710	0.779	1.900	0.664	2.104	0.554	2.318	0.451	2.537	0.356	2.757	0.272	2.975	0.198	3.184
18	1.158	1.391	1.046	1.535	0.933	1.696	0.820	1.872	0.710	2.060	0.603	2.257	0.502	2.461	0.407	2.667	0.321	2.873	0.244	3.073
19	1.180	1.401	1.074	1.536	0.967	1.685	0.859	1.848	0.752	2.023	0.649	2.206	0.549	2.396	0.456	2.589	0.369	2.783	0.290	2.974
20	1.201	1.411	1.100	1.537	0.998	1.676	0.894	1.828	0.792	1.991	0.692	2.162	0.595	2.339	0.502	2.521	0.416	2.704	0.336	2.885
21	1.221	1.420	1.125	1.538	1.026	1.669	0.927	1.812	0.829	1.964	0.732	2.124	0.637	2.290	0.547	2.460	0.461	2.633	0.380	2.806
22	1.239	1.429	1.147	1.541	1.053	1.664	0.958	1.797	0.863	1.940	0.769	2.090	0.677	2.246	0.588	2.407	0.504	2.571	0.424	2.734
23	1.257	1.437	1.168	1.543	1.078	1.660	0.986	1.785	0.895	1.920	0.804	2.061	0.715	2.208	0.628	2.360	0.545	2.514	0.465	2.670
24	1.273	1.446	1.188	1.546	1.101	1.656	1.013	1.775	0.925	1.902	0.837	2.035	0.751	2.174	0.666	2.318	0.584	2.464	0.506	2.613
25	1.288	1.454	1.206	1.550	1.123	1.654	1.038	1.767	0.953	1.886	0.868	2.012	0.784	2.144	0.702	2.280	0.621	2.419	0.544	2.560
26	1.302	1.461	1.224	1.553	1.143	1.652	1.062	1.759	0.979	1.873	0.897	1.992	0.816	2.117	0.735	2.246	0.657	2.379	0.581	2.513
27	1.316	1.469	1.240	1.556	1.162	1.651	1.084	1.753	1.004	1.861	0.925	1.974	0.845	2.093	0.767	2.216	0.691	2.342	0.616	2.470
28	1.328	1.476	1.255	1.560	1.181	1.650	1.104	1.747	1.028	1.850	0.951	1.958	0.874	2.071	0.798	2.188	0.723	2.309	0.650	2.431
29	1.341	1.483	1.270	1.563	1.198	1.650	1.124	1.743	1.050	1.841	0.975	1.944	0.900	2.052	0.826	2.164	0.753	2.278	0.682	2.396
30	1.352	1.489	1.284	1.567	1.214	1.650	1.143	1.739	1.071	1.833	0.998	1.931	0.926	2.034	0.854	2.141	0.782	2.251	0.712	2.363
31	1.363	1.496	1.297	1.570	1.229	1.650	1.160	1.735	1.090	1.825	1.020	1.920	0.950	2.018	0.879	2.120	0.810	2.226	0.741	2.333
32	1.373	1.502	1.309	1.574	1.244	1.650	1.177	1.732	1.109	1.819	1.041	1.909	0.972	2.004	0.904	2.102	0.836	2.203	0.769	2.306
33	1.383	1.508	1.321	1.577	1.258	1.651	1.193	1.730	1.127	1.813	1.061	1.900	0.994	1.991	0.927	2.085	0.861	2.181	0.795	2.281
34	1.393	1.514	1.333	1.580	1.271	1.652	1.208	1.728	1.144	1.808	1.080	1.891	1.015	1.979	0.950	2.069	0.885	2.162	0.821	2.257
35	1.402	1.519	1.343	1.584	1.283	1.653	1.222	1.726	1.160	1.803	1.097	1.884	1.034	1.967	0.971	2.054	0.908	2.144	0.845	2.236
36	1.411	1.525	1.354	1.587	1.295	1.654	1.236	1.724	1.175	1.799	1.114	1.877	1.053	1.957	0.991	2.041	0.930	2.127	0.868	2.216
37	1.419	1.530	1.364	1.590	1.307	1.655	1.249	1.723	1.190	1.795	1.131	1.870	1.071	1.948	1.011	2.029	0.951	2.112	0.891	2.198
38	1.427	1.535	1.373	1.594	1.318	1.656	1.261	1.722	1.204	1.792	1.146	1.864	1.088	1.939	1.029	2.017	0.970	2.098	0.912	2.180
39	1.435	1.540	1.382	1.597	1.328	1.658	1.273	1.722	1.218	1.789	1.161	1.859	1.104	1.932	1.047	2.007	0.990	2.085	0.932	2.164
40	1.442	1.544	1.391	1.600	1.338	1.659	1.285	1.721	1.230	1.786	1.175	1.854	1.120	1.924	1.064	1.997	1.008	2.072	0.952	2.149
45	1.475	1.566	1.430	1.615	1.383	1.666	1.336	1.720	1.287	1.776	1.238	1.835	1.189	1.895	1.139	1.958	1.089	2.022	1.038	2.088
50	1.503	1.585	1.462	1.628	1.421	1.674	1.378	1.721	1.335	1.771	1.291	1.822	1.246	1.875	1.201	1.930	1.156	1.986	1.110	2.044
55	1.528	1.601	1.490	1.641	1.452	1.681	1.414	1.724	1.374	1.768	1.334	1.814	1.294	1.861	1.253	1.909	1.212	1.959	1.170	2.010
60	1.549	1.616	1.514	1.652	1.480	1.689	1.444	1.727	1.408	1.767	1.372	1.808	1.335	1.850	1.298	1.894	1.260	1.939	1.222	1.984
65	1.567	1.629	1.536	1.662	1.503	1.696	1.471	1.731	1.438	1.767	1.404	1.805	1.370	1.843	1.336	1.882	1.301	1.923	1.266	1.964
70	1.583	1.641	1.554	1.672	1.525	1.703	1.494	1.735	1.464	1.768	1.433	1.802	1.401	1.837	1.369	1.873	1.337	1.910	1.305	1.948
75	1.598	1.652	1.571	1.680	1.543	1.709	1.515	1.739	1.487	1.770	1.458	1.801	1.428	1.834	1.399	1.867	1.369	1.901	1.339	1.935
80	1.611	1.662	1.586	1.688	1.560	1.715	1.534	1.743	1.507	1.772	1.480	1.801	1.453	1.831	1.425	1.861	1.397	1.893	1.369	1.925
85	1.624	1.671	1.600	1.696	1.575	1.721	1.550	1.747	1.525	1.774	1.500	1.801	1.474	1.829	1.448	1.857	1.422	1.886	1.396	1.916
90	1.635	1.679	1.612	1.703	1.589	1.726	1.566	1.751	1.542	1.776	1.518	1.801	1.494	1.827	1.469	1.854	1.445	1.881	1.420	1.909
95	1.645	1.687	1.623	1.709	1.602	1.732	1.579	1.755	1.557	1.778	1.535	1.802	1.512	1.827	1.489	1.852	1.465	1.877	1.442	1.903
100	1.654	1.694	1.634	1.715	1.613	1.736	1.592	1.758	1.571	1.780	1.550	1.803	1.528	1.826	1.506	1.850	1.484	1.874	1.462	1.898
150	1.720	1.746	1.706	1.760	1.693	1.774	1.679	1.788	1.665	1.802	1.651	1.817	1.637	1.832	1.622	1.847	1.608	1.862	1.594	1.877
200	1.758	1.778	1.748	1.789	1.738	1.799	1.728	1.810	1.718	1.820	1.707	1.831	1.697	1.841	1.686	1.852	1.675	1.863	1.665	1.874

	$k'=11$		$k'=12$		$k'=13$		$k'=14$		$k'=15$		$k'=16$		$k'=17$		$k'=18$		$k'=19$		$k'=20$	
n	d_L	d_U	d_L	d_U	d_L	d_U	d_L	d_U	d_L	d_U	d_L	d_U	d_L	d_U	d_L	d_U	d_L	d_U	d_L	d_U
16	0.098	3.503	—	—	—	—	—	—	—	—	—	—	—	—	—	—	—	—	—	—
17	0.138	3.378	0.087	3.557	—	—	—	—	—	—	—	—	—	—	—	—	—	—	—	—
18	0.177	3.265	0.123	3.441	0.078	3.603	—	—	—	—	—	—	—	—	—	—	—	—	—	—
19	0.220	3.159	0.160	3.335	0.111	3.496	0.070	3.642	—	—	—	—	—	—	—	—	—	—	—	—
20	0.263	3.063	0.200	3.234	0.143	3.395	0.100	3.542	0.063	3.676	—	—	—	—	—	—	—	—	—	—
21	0.307	2.976	0.240	3.141	0.182	3.300	0.132	3.448	0.091	3.583	0.058	3.705	—	—	—	—	—	—	—	—
22	0.349	2.897	0.281	3.057	0.220	3.211	0.166	3.358	0.120	3.495	0.083	3.619	0.052	3.731	—	—	—	—	—	—
23	0.391	2.826	0.322	2.979	0.259	3.128	0.202	3.272	0.153	3.409	0.110	3.535	0.076	3.650	0.048	3.753	—	—	—	—
24	0.431	2.761	0.362	2.908	0.297	3.053	0.239	3.193	0.186	3.327	0.141	3.454	0.101	3.572	0.070	3.678	0.044	3.773	—	—
25	0.470	2.702	0.400	2.844	0.335	2.983	0.275	3.119	0.221	3.251	0.172	3.376	0.130	3.494	0.094	3.604	0.065	3.702	0.041	3.790
26	0.508	2.649	0.438	2.784	0.373	2.919	0.312	3.051	0.256	3.179	0.205	3.303	0.160	3.420	0.120	3.531	0.087	3.632	0.060	3.724
27	0.544	2.600	0.475	2.730	0.409	2.859	0.348	2.987	0.291	3.112	0.238	3.233	0.191	3.349	0.149	3.460	0.112	3.563	0.081	3.658
28	0.578	2.555	0.510	2.680	0.445	2.805	0.383	2.928	0.325	3.050	0.271	3.168	0.222	3.283	0.178	3.392	0.138	3.495	0.104	3.592
29	0.612	2.515	0.544	2.634	0.479	2.755	0.418	2.874	0.359	2.992	0.305	3.107	0.254	3.219	0.208	3.327	0.166	3.431	0.129	3.528
30	0.643	2.477	0.577	2.592	0.512	2.708	0.451	2.823	0.392	2.937	0.337	3.050	0.286	3.160	0.238	3.266	0.195	3.368	0.156	3.465
31	0.674	2.443	0.608	2.553	0.545	2.665	0.484	2.776	0.425	2.887	0.370	2.996	0.317	3.103	0.269	3.208	0.224	3.309	0.183	3.406
32	0.703	2.411	0.638	2.517	0.576	2.625	0.515	2.733	0.457	2.840	0.401	2.946	0.349	3.050	0.299	3.153	0.253	3.252	0.211	3.348
33	0.731	2.382	0.668	2.484	0.606	2.588	0.546	2.692	0.488	2.796	0.432	2.899	0.379	3.000	0.329	3.100	0.283	3.198	0.239	3.293
34	0.758	2.355	0.695	2.454	0.634	2.554	0.575	2.654	0.518	2.754	0.462	2.854	0.409	2.954	0.359	3.051	0.312	3.147	0.267	3.240
35	0.783	2.330	0.722	2.425	0.662	2.521	0.604	2.619	0.547	2.716	0.492	2.813	0.439	2.910	0.388	3.005	0.340	3.099	0.295	3.190
36	0.808	2.306	0.748	2.398	0.689	2.492	0.631	2.586	0.575	2.680	0.520	2.774	0.467	2.868	0.417	2.961	0.369	3.053	0.323	3.142
37	0.831	2.285	0.772	2.374	0.714	2.464	0.657	2.555	0.602	2.646	0.548	2.738	0.495	2.829	0.445	2.920	0.397	3.009	0.351	3.097
38	0.854	2.265	0.796	2.351	0.739	2.438	0.683	2.526	0.628	2.614	0.575	2.703	0.522	2.792	0.472	2.880	0.424	2.968	0.378	3.054
39	0.875	2.246	0.819	2.329	0.763	2.413	0.707	2.499	0.653	2.585	0.600	2.671	0.549	2.757	0.499	2.843	0.451	2.929	0.404	3.013
40	0.896	2.228	0.840	2.309	0.785	2.391	0.731	2.473	0.678	2.557	0.626	2.641	0.575	2.724	0.525	2.808	0.477	2.892	0.430	2.974
45	0.988	2.156	0.938	2.225	0.887	2.296	0.838	2.367	0.788	2.439	0.740	2.512	0.692	2.586	0.644	2.659	0.598	2.733	0.553	2.807
50	1.064	2.103	1.019	2.163	0.973	2.225	0.927	2.287	0.882	2.350	0.836	2.414	0.792	2.479	0.747	2.544	0.703	2.610	0.660	2.675
55	1.129	2.062	1.087	2.116	1.045	2.170	1.003	2.225	0.961	2.281	0.919	2.338	0.877	2.396	0.836	2.454	0.795	2.512	0.754	2.571
60	1.184	2.031	1.145	2.079	1.106	2.127	1.068	2.177	1.029	2.227	0.990	2.278	0.951	2.330	0.913	2.382	0.874	2.434	0.836	2.487
65	1.231	2.006	1.195	2.049	1.160	2.093	1.124	2.138	1.088	2.183	1.052	2.229	1.016	2.276	0.980	2.323	0.944	2.371	0.908	2.419
70	1.272	1.986	1.239	2.026	1.206	2.066	1.172	2.106	1.139	2.148	1.105	2.189	1.072	2.232	1.038	2.275	1.005	2.318	0.971	2.362
75	1.308	1.970	1.277	2.006	1.247	2.043	1.215	2.080	1.184	2.118	1.153	2.156	1.121	2.195	1.090	2.235	1.058	2.275	1.027	2.315
80	1.340	1.957	1.311	1.991	1.283	2.024	1.253	2.059	1.224	2.093	1.195	2.129	1.165	2.165	1.136	2.201	1.106	2.238	1.076	2.275
85	1.369	1.946	1.342	1.977	1.315	2.009	1.287	2.040	1.260	2.073	1.232	2.105	1.205	2.139	1.177	2.172	1.149	2.206	1.121	2.241
90	1.395	1.937	1.369	1.966	1.344	1.995	1.318	2.025	1.292	2.055	1.266	2.085	1.240	2.116	1.213	2.148	1.187	2.179	1.160	2.211
95	1.418	1.929	1.394	1.956	1.370	1.984	1.345	2.012	1.321	2.040	1.296	2.068	1.271	2.097	1.247	2.126	1.222	2.156	1.197	2.186
100	1.439	1.923	1.416	1.948	1.393	1.974	1.371	2.000	1.347	2.026	1.324	2.053	1.301	2.080	1.277	2.108	1.253	2.135	1.229	2.164
150	1.579	1.892	1.564	1.908	1.550	1.924	1.535	1.940	1.519	1.956	1.504	1.972	1.489	1.989	1.474	2.006	1.458	2.023	1.443	2.040
200	1.654	1.885	1.643	1.896	1.632	1.908	1.621	1.919	1.610	1.931	1.599	1.943	1.588	1.955	1.576	1.967	1.565	1.979	1.554	1.991

Note: n = number of observations, k' = number of explanatory variables excluding the constant term.

Source: This table is an extension of the original Durbin–Watson table and is reproduced from N. E. Savin and K. J. White, "The Durbin-Watson Test for Serial Correlation with Extreme Small Samples or Many Regressors," *Econometrica*, vol. 45, November 1977, pp. 1989–96 and as corrected by R. W. Farebrother, *Econometrica*, vol. 48, September 1980, p. 1554. Reprinted by permission of the Econometric Society.

EXAMPLE 1 If $n = 40$ and $k' = 4$; $d_L = 1.285$ and $d_U = 1.721$. If a computed d value is less than 1.285, there is evidence of positive first-order serial correlation; if it is greater than 1.721, there is no evidence of positive first-order serial correlation; but if d lies between the lower and the upper limit, there is inconclusive evidence regarding the presence or absence of positive first-order serial correlation.

TABLE D.5B Durbin–Watson *d* Statistic: Significance Points of d_L and d_U at 0.01 Level of Significance

	$k=1$		$k=2$		$k=3$		$k=4$		$k=5$		$k=6$		$k=7$		$k=8$		$k=9$		$k=10$	
n	d_L	d_U	d_L	d_U	d_L	d_U	d_L	d_U	d_L	d_U	d_L	d_U	d_L	d_U	d_L	d_U	d_L	d_U	d_L	d_U
6	0.390	1.142	—	—	—	—	—	—	—	—	—	—	—	—	—	—	—	—	—	—
7	0.435	1.036	0.294	1.676	—	—	—	—	—	—	—	—	—	—	—	—	—	—	—	—
8	0.497	1.003	0.345	1.489	0.229	2.102	—	—	—	—	—	—	—	—	—	—	—	—	—	—
9	0.554	0.998	0.408	1.389	0.279	1.875	0.183	2.433	—	—	—	—	—	—	—	—	—	—	—	—
10	0.604	1.001	0.466	1.333	0.340	1.733	0.230	2.193	0.150	2.690	—	—	—	—	—	—	—	—	—	—
11	0.653	1.010	0.519	1.297	0.396	1.640	0.286	2.030	0.193	2.453	0.124	2.892	—	—	—	—	—	—	—	—
12	0.697	1.023	0.569	1.274	0.449	1.575	0.339	1.913	0.244	2.280	0.164	2.665	0.105	3.053	—	—	—	—	—	—
13	0.738	1.038	0.616	1.261	0.499	1.526	0.391	1.826	0.294	2.150	0.211	2.490	0.140	2.838	0.090	3.182	—	—	—	—
14	0.776	1.054	0.660	1.254	0.547	1.490	0.441	1.757	0.343	2.049	0.257	2.354	0.183	2.667	0.122	2.981	0.078	3.287	—	—
15	0.811	1.070	0.700	1.252	0.591	1.464	0.488	1.704	0.391	1.967	0.303	2.244	0.226	2.530	0.161	2.817	0.107	3.101	0.068	3.374
16	0.844	1.086	0.737	1.252	0.633	1.446	0.532	1.663	0.437	1.900	0.349	2.153	0.269	2.416	0.200	2.681	0.142	2.944	0.094	3.201
17	0.874	1.102	0.772	1.255	0.672	1.432	0.574	1.630	0.480	1.847	0.393	2.078	0.313	2.319	0.241	2.566	0.179	2.811	0.127	3.053
18	0.902	1.118	0.805	1.259	0.708	1.422	0.613	1.604	0.522	1.803	0.435	2.015	0.355	2.238	0.282	2.467	0.216	2.697	0.160	2.925
19	0.928	1.132	0.835	1.265	0.742	1.415	0.650	1.584	0.561	1.767	0.476	1.963	0.396	2.169	0.322	2.381	0.255	2.597	0.196	2.813
20	0.952	1.147	0.863	1.271	0.773	1.411	0.685	1.567	0.598	1.737	0.515	1.918	0.436	2.110	0.362	2.308	0.294	2.510	0.232	2.714
21	0.975	1.161	0.890	1.277	0.803	1.408	0.718	1.554	0.633	1.712	0.552	1.881	0.474	2.059	0.400	2.244	0.331	2.434	0.268	2.625
22	0.997	1.174	0.914	1.284	0.831	1.407	0.748	1.543	0.667	1.691	0.587	1.849	0.510	2.015	0.437	2.188	0.368	2.367	0.304	2.548
23	1.018	1.187	0.938	1.291	0.858	1.407	0.777	1.534	0.698	1.673	0.620	1.821	0.545	1.977	0.473	2.140	0.404	2.308	0.340	2.479
24	1.037	1.199	0.960	1.298	0.882	1.407	0.805	1.528	0.728	1.658	0.652	1.797	0.578	1.944	0.507	2.097	0.439	2.255	0.375	2.417
25	1.055	1.211	0.981	1.305	0.906	1.409	0.831	1.523	0.756	1.645	0.682	1.776	0.610	1.915	0.540	2.059	0.473	2.209	0.409	2.362
26	1.072	1.222	1.001	1.312	0.928	1.411	0.855	1.518	0.783	1.635	0.711	1.759	0.640	1.889	0.572	2.026	0.505	2.168	0.441	2.313
27	1.089	1.233	1.019	1.319	0.949	1.413	0.878	1.515	0.808	1.626	0.738	1.743	0.669	1.867	0.602	1.997	0.536	2.131	0.473	2.269
28	1.104	1.244	1.037	1.325	0.969	1.415	0.900	1.513	0.832	1.618	0.764	1.729	0.696	1.847	0.630	1.970	0.566	2.098	0.504	2.229
29	1.119	1.254	1.054	1.332	0.988	1.418	0.921	1.512	0.855	1.611	0.788	1.718	0.723	1.830	0.658	1.947	0.595	2.068	0.533	2.193
30	1.133	1.263	1.070	1.339	1.008	1.421	0.941	1.511	0.877	1.606	0.812	1.707	0.748	1.814	0.684	1.925	0.622	2.041	0.562	2.160
31	1.147	1.273	1.085	1.345	1.023	1.425	0.960	1.510	0.897	1.601	0.834	1.698	0.772	1.800	0.710	1.906	0.649	2.017	0.589	2.131
32	1.160	1.282	1.100	1.352	1.040	1.428	0.979	1.510	0.917	1.597	0.856	1.690	0.794	1.788	0.734	1.889	0.674	1.995	0.615	2.104
33	1.172	1.291	1.114	1.358	1.055	1.432	0.996	1.510	0.936	1.594	0.876	1.683	0.816	1.776	0.757	1.874	0.698	1.975	0.641	2.080
34	1.184	1.299	1.128	1.364	1.070	1.435	1.012	1.511	0.954	1.591	0.896	1.677	0.837	1.766	0.779	1.860	0.722	1.957	0.665	2.057
35	1.195	1.307	1.140	1.370	1.085	1.439	1.028	1.512	0.971	1.589	0.914	1.671	0.857	1.757	0.800	1.847	0.744	1.940	0.689	2.037
36	1.206	1.315	1.153	1.376	1.098	1.442	1.043	1.513	0.988	1.588	0.932	1.666	0.877	1.749	0.821	1.836	0.766	1.925	0.711	2.018
37	1.217	1.323	1.165	1.382	1.112	1.446	1.058	1.514	1.004	1.586	0.950	1.662	0.895	1.742	0.841	1.825	0.787	1.911	0.733	2.001
38	1.227	1.330	1.176	1.388	1.124	1.449	1.072	1.515	1.019	1.585	0.966	1.658	0.913	1.735	0.860	1.816	0.807	1.899	0.754	1.985
39	1.237	1.337	1.187	1.393	1.137	1.453	1.085	1.517	1.034	1.584	0.982	1.655	0.930	1.729	0.878	1.807	0.826	1.887	0.774	1.970
40	1.246	1.344	1.198	1.398	1.148	1.457	1.098	1.518	1.048	1.584	0.997	1.652	0.946	1.724	0.895	1.799	0.844	1.876	0.749	1.956
45	1.288	1.376	1.245	1.423	1.201	1.474	1.156	1.528	1.111	1.584	1.065	1.643	1.019	1.704	0.974	1.768	0.927	1.834	0.881	1.902
50	1.324	1.403	1.285	1.446	1.245	1.491	1.205	1.538	1.164	1.587	1.123	1.639	1.081	1.692	1.039	1.748	0.997	1.805	0.955	1.864
55	1.356	1.427	1.320	1.466	1.284	1.506	1.247	1.548	1.209	1.592	1.172	1.638	1.134	1.685	1.095	1.734	1.057	1.785	1.018	1.837
60	1.383	1.449	1.350	1.484	1.317	1.520	1.283	1.558	1.249	1.598	1.214	1.639	1.179	1.682	1.144	1.726	1.108	1.771	1.072	1.817
65	1.407	1.468	1.377	1.500	1.346	1.534	1.315	1.568	1.283	1.604	1.251	1.642	1.218	1.680	1.186	1.720	1.153	1.761	1.120	1.802
70	1.429	1.485	1.400	1.515	1.372	1.546	1.343	1.578	1.313	1.611	1.283	1.645	1.253	1.680	1.223	1.716	1.192	1.754	1.162	1.792
75	1.448	1.501	1.422	1.529	1.395	1.557	1.368	1.587	1.340	1.617	1.313	1.649	1.284	1.682	1.256	1.714	1.227	1.748	1.199	1.783
80	1.466	1.515	1.441	1.541	1.416	1.568	1.390	1.595	1.364	1.624	1.338	1.653	1.312	1.683	1.285	1.714	1.259	1.745	1.232	1.777
85	1.482	1.528	1.458	1.553	1.435	1.578	1.411	1.603	1.386	1.630	1.362	1.657	1.337	1.685	1.312	1.714	1.287	1.743	1.262	1.773
90	1.496	1.540	1.474	1.563	1.452	1.587	1.429	1.611	1.406	1.636	1.383	1.661	1.360	1.687	1.336	1.714	1.312	1.741	1.288	1.769
95	1.510	1.552	1.489	1.573	1.468	1.596	1.446	1.618	1.425	1.642	1.403	1.666	1.381	1.690	1.358	1.715	1.336	1.741	1.313	1.767
100	1.522	1.562	1.503	1.583	1.482	1.604	1.462	1.625	1.441	1.647	1.421	1.670	1.400	1.693	1.378	1.717	1.357	1.741	1.335	1.765
150	1.611	1.637	1.598	1.651	1.584	1.665	1.571	1.679	1.557	1.693	1.543	1.708	1.530	1.722	1.515	1.737	1.501	1.752	1.486	1.767
200	1.664	1.684	1.653	1.693	1.643	1.704	1.633	1.715	1.623	1.725	1.613	1.735	1.603	1.746	1.592	1.757	1.582	1.768	1.571	1.779

	$k' = 11$		$k' = 12$		$k' = 13$		$k' = 14$		$k' = 15$		$k' = 16$		$k' = 17$		$k' = 18$		$k' = 19$		$k' = 20$	
n	d_L	d_U	d_L	d_U	d_L	d_U	d_L	d_U	d_L	d_U	d_L	d_U	d_L	d_U	d_L	d_U	d_L	d_U	d_L	d_U
16	0.098	3.446	—	—	—	—	—	—	—	—	—	—	—	—	—	—	—	—	—	—
17	0.098	3.286	0.053	3.506	—	—	—	—	—	—	—	—	—	—	—	—	—	—	—	—
18	0.138	3.146	0.075	3.359	0.047	3.557	—	—	—	—	—	—	—	—	—	—	—	—	—	—
19	0.148	3.023	0.102	3.227	0.067	3.420	0.043	3.601	—	—	—	—	—	—	—	—	—	—	—	—
20	0.178	2.914	0.231	3.109	0.092	3.297	0.061	3.474	0.038	3.639	—	—	—	—	—	—	—	—	—	—
21	0.212	2.815	0.182	3.004	0.119	3.185	0.084	3.358	0.055	3.521	0.033	3.671	—	—	—	—	—	—	—	—
22	0.246	2.729	0.204	2.909	0.148	3.084	0.109	3.252	0.077	3.412	0.050	3.562	0.032	3.700	—	—	—	—	—	—
23	0.281	2.651	0.237	2.822	0.178	2.991	0.136	3.155	0.100	3.311	0.070	3.439	0.046	3.597	0.029	3.725	—	—	—	—
24	0.315	2.580	0.269	2.744	0.209	2.906	0.165	3.065	0.125	3.218	0.092	3.363	0.065	3.501	0.043	3.629	0.027	3.747	—	—
25	0.348	2.517	0.292	2.674	0.240	2.829	0.194	2.982	0.152	3.131	0.116	3.274	0.085	3.410	0.060	3.538	0.039	3.657	0.025	3.766
26	0.381	2.460	0.324	2.610	0.272	2.758	0.224	2.906	0.180	3.050	0.141	3.191	0.107	3.325	0.079	3.452	0.055	3.572	0.036	3.682
27	0.413	2.409	0.359	2.552	0.303	2.694	0.253	2.836	0.208	2.978	0.167	3.113	0.131	3.245	0.100	3.371	0.073	3.490	0.051	3.602
28	0.444	2.363	0.387	2.499	0.333	2.635	0.283	2.772	0.237	2.907	0.194	3.040	0.156	3.169	0.122	3.294	0.091	3.412	0.068	3.524
29	0.474	2.321	0.417	2.451	0.363	2.582	0.313	2.713	0.266	2.843	0.222	2.972	0.182	3.098	0.146	3.220	0.114	3.338	0.087	3.450
30	0.503	2.283	0.447	2.407	0.393	2.533	0.342	2.659	0.294	2.785	0.249	2.909	0.208	3.032	0.171	3.152	0.137	3.267	0.107	3.379
31	0.531	2.248	0.475	2.367	0.422	2.487	0.371	2.609	0.322	2.730	0.277	2.851	0.234	2.970	0.196	3.087	0.160	3.201	0.128	3.311
32	0.558	2.276	0.503	2.330	0.450	2.445	0.399	2.563	0.350	2.680	0.304	2.797	0.261	2.912	0.221	3.026	0.184	3.137	0.151	3.246
33	0.583	2.157	0.530	2.298	0.477	2.408	0.426	2.520	0.377	2.633	0.331	2.746	0.287	2.858	0.246	2.969	0.209	3.078	0.174	3.184
34	0.610	2.160	0.556	2.268	0.503	2.373	0.452	2.481	0.404	2.590	0.357	2.699	0.313	2.808	0.272	2.915	0.233	3.022	0.197	3.126
35	0.634	2.136	0.581	2.237	0.529	2.340	0.478	2.444	0.430	2.550	0.383	2.655	0.339	2.761	0.297	2.865	0.257	2.969	0.221	3.071
36	0.658	2.113	0.605	2.210	0.554	2.310	0.504	2.410	0.455	2.512	0.409	2.614	0.364	2.717	0.322	2.818	0.282	2.919	0.244	3.019
37	0.680	2.092	0.628	2.186	0.578	2.282	0.528	2.379	0.480	2.477	0.434	2.576	0.389	2.675	0.347	2.774	0.306	2.872	0.268	2.969
38	0.702	2.073	0.651	2.164	0.601	2.255	0.552	2.350	0.504	2.445	0.458	2.540	0.414	2.637	0.371	2.733	0.330	2.828	0.291	2.923
39	0.723	2.055	0.673	2.143	0.623	2.232	0.575	2.323	0.528	2.414	0.482	2.507	0.438	2.600	0.395	2.694	0.354	2.787	0.315	2.879
40	0.744	2.039	0.694	2.123	0.645	2.210	0.597	2.297	0.551	2.386	0.505	2.476	0.461	2.566	0.418	2.657	0.377	2.748	0.338	2.838
45	0.835	1.972	0.790	2.044	0.744	2.118	0.700	2.193	0.655	2.269	0.612	2.346	0.570	2.424	0.528	2.503	0.488	2.582	0.448	2.661
50	0.913	1.925	0.871	1.987	0.829	2.051	0.787	2.116	0.746	2.182	0.705	2.250	0.665	2.318	0.625	2.387	0.586	2.456	0.548	2.526
55	0.979	1.891	0.940	1.945	0.902	2.002	0.863	2.059	0.825	2.117	0.786	2.176	0.748	2.237	0.711	2.298	0.674	2.359	0.637	2.421
60	1.037	1.865	1.001	1.914	0.965	1.964	0.929	2.015	0.893	2.067	0.857	2.120	0.822	2.173	0.786	2.227	0.751	2.283	0.716	2.338
65	1.087	1.845	1.053	1.889	1.020	1.934	0.986	1.980	0.953	2.027	0.919	2.075	0.886	2.123	0.852	2.172	0.819	2.221	0.786	2.272
70	1.131	1.831	1.099	1.870	1.068	1.911	1.037	1.953	1.005	1.995	0.974	2.038	0.943	2.082	0.911	2.127	0.880	2.172	0.849	2.217
75	1.170	1.819	1.141	1.856	1.111	1.893	1.082	1.931	1.052	1.970	1.023	2.009	0.993	2.049	0.964	2.090	0.934	2.131	0.905	2.172
80	1.205	1.810	1.177	1.844	1.150	1.878	1.122	1.913	1.094	1.949	1.066	1.984	1.039	2.022	1.011	2.059	0.983	2.097	0.955	2.135
85	1.236	1.803	1.210	1.834	1.184	1.866	1.158	1.898	1.132	1.931	1.106	1.965	1.080	1.999	1.053	2.033	1.027	2.068	1.000	2.104
90	1.264	1.798	1.240	1.827	1.215	1.855	1.191	1.886	1.166	1.917	1.141	1.948	1.116	1.979	1.091	2.012	1.066	2.044	1.041	2.077
95	1.290	1.793	1.267	1.821	1.244	1.848	1.221	1.876	1.197	1.905	1.174	1.934	1.150	1.963	1.126	1.993	1.102	2.023	1.079	2.054
100	1.314	1.790	1.292	1.816	1.270	1.841	1.248	1.868	1.225	1.895	1.203	1.922	1.181	1.949	1.158	1.977	1.136	2.006	1.113	2.034
150	1.473	1.783	1.458	1.799	1.444	1.814	1.429	1.830	1.414	1.847	1.400	1.863	1.385	1.880	1.370	1.897	1.355	1.913	1.340	1.931
200	1.561	1.791	1.550	1.801	1.539	1.813	1.528	1.824	1.518	1.836	1.507	1.847	1.495	1.860	1.484	1.871	1.474	1.883	1.462	1.896

Note: n = number of observations.
k' = number of explanatory variables excluding the constant term.
Source: Savin and White, op. cit., by permission of the Econometric Society.

Table A.3 Standard Normal Curve Areas

$(z) = P(Z \le z)$

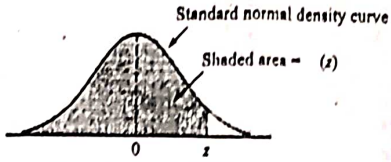

z	.00	.01	.02	.03	.04	.05	.06	.07	.08	.09
−3.4	.0003	.0003	.0003	.0003	.0003	.0003	.0003	.0003	.0003	.0002
−3.3	.0005	.0005	.0005	.0004	.0004	.0004	.0004	.0004	.0004	.0003
−3.2	.0007	.0007	.0006	.0006	.0006	.0006	.0006	.0005	.0005	.0005
−3.1	.0010	.0009	.0009	.0009	.0008	.0008	.0008	.0008	.0007	.0007
−3.0	.0013	.0013	.0013	.0012	.0012	.0011	.0011	.0011	.0010	.0010
−2.9	.0019	.0018	.0017	.0017	.0016	.0016	.0015	.0015	.0014	.0014
−2.8	.0026	.0025	.0024	.0023	.0023	.0022	.0021	.0021	.0020	.0019
−2.7	.0035	.0034	.0033	.0032	.0031	.0030	.0029	.0028	.0027	.0026
−2.6	.0047	.0045	.0044	.0043	.0041	.0040	.0039	.0038	.0037	.0036
−2.5	.0062	.0060	.0059	.0057	.0055	.0054	.0052	.0051	.0049	.0038
−2.4	.0082	.0080	.0078	.0075	.0073	.0071	.0069	.0068	.0066	.0064
−2.3	.0107	.0104	.0102	.0099	.0096	.0094	.0091	.0089	.0087	.0084
−2.2	.0139	.0136	.0132	.0129	.0125	.0122	.0119	.0116	.0113	.0110
−2.1	.0179	.0174	.0170	.0166	.0162	.0158	.0154	.0150	.0146	.0143
−2.0	.0228	.0222	.0217	.0212	.0207	.0202	.0197	.0192	.0188	.0183
−1.9	.0287	.0281	.0274	.0268	.0262	.0256	.0250	.0244	.0239	.0233
−1.8	.0359	.0352	.0344	.0336	.0329	.0322	.0314	.0307	.0301	.0294
−1.7	.0446	.0436	.0427	.0418	.0409	.0401	.0392	.0384	.0375	.0367
−1.6	.0548	.0537	.0526	.0516	.0505	.0495	.0485	.0475	.0465	.0455
−1.5	.0668	.0655	.0643	.0630	.0618	.0606	.0594	.0582	.0571	.0559
−1.4	.0808	.0793	.0778	.0764	.0749	.0735	.0722	.0708	.0694	.0681
−1.3	.0968	.0951	.0934	.0918	.0901	.0885	.0869	.0853	.0838	.0823
−1.2	.1151	.1131	.1112	.1093	.1075	.1056	.1038	.1020	.1003	.0985
−1.1	.1357	.1335	.1314	.1292	.1271	.1251	.1230	.1210	.1190	.1170
−1.0	.1587	.1562	.1539	.1515	.1492	.1469	.1446	.1423	.1401	.1379
−0.9	.1841	.1814	.1788	.1762	.1736	.1711	.1685	.1660	.1635	.1611
−0.8	.2119	.2090	.2061	.2033	.2005	.1977	.1949	.1922	.1894	.1867
−0.7	.2420	.2389	.2358	.2327	.2296	.2266	.2236	.2206	.2177	.2148
−0.6	.2743	.2709	.2676	.2643	.2611	.2578	.2546	.2514	.2483	.2451
−0.5	.3085	.3050	.3015	.2981	.2946	.2912	.2877	.2843	.2810	.2776
−0.4	.3446	.3409	.3372	.3336	.3300	.3264	.3228	.3192	.3156	.3121
−0.3	.3821	.3783	.3745	.3707	.3669	.3632	.3594	.3557	.3520	.3482
−0.2	.4207	.4168	.4129	.4090	.4052	.4013	.3974	.3936	.3897	.3859
−0.1	.4602	.4562	.4522	.4483	.4443	.4404	.4364	.4325	.4286	.4247
−0.0	.5000	.4960	.4920	.4880	.4840	.4801	.4761	.4721	.4681	.4641

(continued)

Table A.3 Standard Normal Curve Areas *(cont.)*

$\Phi(z) = P(Z \le z)$

z	.00	.01	.02	.03	.04	.05	.06	.07	.08	.09
0.0	.5000	.5040	.5080	.5120	.5160	.5199	.5239	.5279	.5319	.5359
0.1	.5398	.5438	.5478	.5517	.5557	.5596	.5636	.5675	.5714	.5753
0.2	.5793	.5832	.5871	.5910	.5948	.5987	.6026	.6064	.6103	.6141
0.3	.6179	.6217	.6255	.6293	.6331	.6368	.6406	.6443	.6480	.6517
0.4	.6554	.6591	.6628	.6664	.6700	.6736	.6772	.6808	.6844	.6879
0.5	.6915	.6950	.6985	.7019	.7054	.7088	.7123	.7157	.7190	.7224
0.6	.7257	.7291	.7324	.7357	.7389	.7422	.7454	.7486	.7517	.7549
0.7	.7580	.7611	.7642	.7673	.7704	.7734	.7764	.7794	.7823	.7852
0.8	.7881	.7910	.7939	.7967	.7995	.8023	.8051	.8078	.8106	.8133
0.9	.8159	.8186	.8212	.8238	.8264	.8289	.8315	.8340	.8365	.8389
1.0	.8413	.8438	.8461	.8485	.8508	.8531	.8554	.8577	.8599	.8621
1.1	.8643	.8665	.8686	.8708	.8729	.8749	.8770	.8790	.8810	.8830
1.2	.8849	.8869	.8888	.8907	.8925	.8944	.8962	.8980	.8997	.9015
1.3	.9032	.9049	.9066	.9082	.9099	.9115	.9131	.9147	.9162	.9177
1.4	.9192	.9207	.9222	.9236	.9251	.9265	.9278	.9292	.9306	.9319
1.5	.9332	.9345	.9357	.9370	.9382	.9394	.9406	.9418	.9429	.9441
1.6	.9452	.9463	.9474	.9484	.9495	.9505	.9515	.9525	.9535	.9545
1.7	.9554	.9564	.9573	.9582	.9591	.9599	.9608	.9616	.9625	.9633
1.8	.9641	.9649	.9656	.9664	.9671	.9678	.9686	.9693	.9699	.9706
1.9	.9713	.9719	.9726	.9732	.9738	.9744	.9750	.9756	.9761	.9767
2.0	.9772	.9778	.9783	.9788	.9793	.9798	.9803	.9808	.9812	.9817
2.1	.9821	.9826	.9830	.9834	.9838	.9842	.9846	.9850	.9854	.9857
2.2	.9861	.9864	.9868	.9871	.9875	.9878	.9881	.9884	.9887	.9890
2.3	.9893	.9896	.9898	.9901	.9904	.9906	.9909	.9911	.9913	.9916
2.4	.9918	.9920	.9922	.9925	.9927	.9929	.9931	.9932	.9934	.9936
2.5	.9938	.9940	.9941	.9943	.9945	.9946	.9948	.9949	.9951	.9952
2.6	.9953	.9955	.9956	.9957	.9959	.9960	.9961	.9962	.9963	.9964
2.7	.9965	.9966	.9967	.9968	.9969	.9970	.9971	.9972	.9973	.9974
2.8	.9974	.9975	.9976	.9977	.9977	.9978	.9979	.9979	.9980	.9981
2.9	.9981	.9982	.9982	.9983	.9984	.9984	.9985	.9985	.9986	.9986
3.0	.9987	.9987	.9987	.9988	.9988	.9989	.9989	.9989	.9990	.9990
3.1	.9990	.9991	.9991	.9991	.9992	.9992	.9992	.9992	.9993	.9993
3.2	.9993	.9993	.9994	.9994	.9994	.9994	.9994	.9995	.9995	.9995
3.3	.9995	.9995	.9995	.9996	.9996	.9996	.9996	.9996	.9996	.9997
3.4	.9997	.9997	.9997	.9997	.9997	.9997	.9997	.9997	.9997	.9998

Table A.5 Critical Values for t Distributions

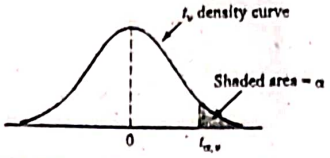

ν \ α	.10	.05	.025	.01	.005	.001	.0005
1	3.078	6.314	12.706	31.821	63.657	318.31	636.62
2	1.886	2.920	4.303	6.965	9.925	22.326	31.598
3	1.638	2.353	3.182	4.541	5.841	10.213	12.924
4	1.533	2.132	2.776	3.747	4.604	7.173	8.610
5	1.476	2.015	2.571	3.365	4.032	5.893	6.869
6	1.440	1.943	2.447	3.143	3.707	5.208	5.959
7	1.415	1.895	2.365	2.998	3.499	4.785	5.408
8	1.397	1.860	2.306	2.896	3.355	4.501	5.041
9	1.383	1.833	2.262	2.821	3.250	4.297	4.781
10	1.372	1.812	2.228	2.764	3.169	4.144	4.587
11	1.363	1.796	2.201	2.718	3.106	4.025	4.437
12	1.356	1.782	2.179	2.681	3.055	3.930	4.318
13	1.350	1.771	2.160	2.650	3.012	3.852	4.221
14	1.345	1.761	2.145	2.624	2.977	3.787	4.140
15	1.341	1.753	2.131	2.602	2.947	3.733	4.073
16	1.337	1.746	2.120	2.583	2.921	3.686	4.015
17	1.333	1.740	2.110	2.567	2.898	3.646	3.965
18	1.330	1.734	2.101	2.552	2.878	3.610	3.922
19	1.328	1.729	2.093	2.539	2.861	3.579	3.883
20	1.325	1.725	2.086	2.528	2.845	3.552	3.850
21	1.323	1.721	2.080	2.518	2.831	3.527	3.819
22	1.321	1.717	2.074	2.508	2.819	3.505	3.792
23	1.319	1.714	2.069	2.500	2.807	3.485	3.767
24	1.318	1.711	2.064	2.492	2.797	3.467	3.745
25	1.316	1.708	2.060	2.485	2.787	3.450	3.725
26	1.315	1.706	2.056	2.479	2.779	3.435	3.707
27	1.314	1.703	2.052	2.473	2.771	3.421	3.690
28	1.313	1.701	2.048	2.467	2.763	3.408	3.674
29	1.311	1.699	2.045	2.462	2.756	3.396	3.659
30	1.310	1.697	2.042	2.457	2.750	3.385	3.646
32	1.309	1.694	2.037	2.449	2.738	3.365	3.622
34	1.307	1.691	2.032	2.441	2.728	3.348	3.601
36	1.306	1.688	2.028	2.434	2.719	3.333	3.582
38	1.304	1.686	2.024	2.429	2.712	3.319	3.566
40	1.303	1.684	2.021	2.423	2.704	3.307	3.551
50	1.299	1.676	2.009	2.403	2.678	3.262	3.496
60	1.296	1.671	2.000	2.390	2.660	3.232	3.460
120	1.289	1.658	1.980	2.358	2.617	3.160	3.373
	1.282	1.645	1.960	2.326	2.576	3.090	3.291

Table A.6 Tolerance Critical Values for Normal Population Distributions

	Two-sided Intervals						One-sided Intervals					
Confidence Level	**95%**			**99%**			**95%**			**99%**		
% of Population Captured	≥ 90%	≥ 95%	≥ 99%	≥ 90%	≥ 95%	≥ 99%	≥ 90%	≥ 95%	≥ 99%	≥ 90%	≥ 95%	≥ 99%
2	32.019	37.674	48.430	160.193	188.491	242.300	20.581	26.260	37.094	103.029	131.426	185.617
3	8.380	9.916	12.861	18.930	22.401	29.055	6.156	7.656	10.553	13.995	17.370	23.896
4	5.369	6.370	8.299	9.398	11.150	14.527	4.162	5.144	7.042	7.380	9.083	12.387
5	4.275	5.079	6.634	6.612	7.855	10.260	3.407	4.203	5.741	5.362	6.578	8.939
6	3.712	4.414	5.775	5.337	6.345	8.301	3.006	3.708	5.062	4.411	5.406	7.335
7	3.369	4.007	5.248	4.613	5.488	7.187	2.756	3.400	4.642	3.859	4.728	6.412
8	3.136	3.732	4.891	4.147	4.936	6.468	2.582	3.187	4.354	3.497	4.285	5.812
9	2.967	3.532	4.631	3.822	4.550	5.966	2.454	3.031	4.143	3.241	3.972	5.389
10	2.839	3.379	4.433	3.582	4.265	5.594	2.355	2.911	3.981	3.048	3.738	5.074
11	2.737	3.259	4.277	3.397	4.045	5.308	2.275	2.815	3.852	2.898	3.556	4.829
12	2.655	3.162	4.150	3.250	3.870	5.079	2.210	2.736	3.747	2.777	3.410	4.633
13	2.587	3.081	4.044	3.130	3.727	4.893	2.155	2.671	3.659	2.677	3.290	4.472
14	2.529	3.012	3.955	3.029	3.608	4.737	2.109	2.615	3.585	2.593	3.189	4.337
15	2.480	2.954	3.878	2.945	3.507	4.605	2.068	2.566	3.520	2.522	3.102	4.222
16	2.437	2.903	3.812	2.872	3.421	4.492	2.033	2.524	3.464	2.460	3.028	4.123
Sample Size *n* **17**	2.400	2.858	3.754	2.808	3.345	4.393	2.002	2.486	3.414	2.405	2.963	4.037
18	2.366	2.819	3.702	2.753	3.279	4.307	1.974	2.453	3.370	2.357	2.905	3.960
19	2.337	2.784	3.656	2.703	3.221	4.230	1.949	2.423	3.331	2.314	2.854	3.892
20	2.310	2.752	3.615	2.659	3.168	4.161	1.926	2.396	3.295	2.276	2.808	3.832
25	2.208	2.631	3.457	2.494	2.972	3.904	1.838	2.292	3.158	2.129	2.633	3.601
30	2.140	2.549	3.350	2.385	2.841	3.733	1.777	2.220	3.064	2.030	2.516	3.447
35	2.090	2.490	3.272	2.306	2.748	3.611	1.732	2.167	2.995	1.957	2.430	3.334
40	2.052	2.445	3.213	2.247	2.677	3.518	1.697	2.126	2.941	1.902	2.364	3.249
45	2.021	2.408	3.165	2.200	2.621	3.444	1.669	2.092	2.898	1.857	2.312	3.180
50	1.996	2.379	3.126	2.162	2.576	3.385	1.646	2.065	2.863	1.821	2.269	3.123
60	1.958	2.333	3.066	2.103	2.506	3.293	1.609	2.022	2.807	1.764	2.202	3.038
70	1.929	2.299	3.021	2.060	2.454	3.225	1.581	1.990	2.765	1.722	2.153	2.974
80	1.907	2.272	2.986	2.026	2.414	3.173	1.559	1.965	2.733	1.688	2.114	2.924
90	1.889	2.251	2.958	1.999	2.382	3.130	1.542	1.944	2.706	1.661	2.082	2.883
100	1.874	2.233	2.934	1.977	2.355	3.096	1.527	1.927	2.684	1.639	2.056	2.850
150	1.825	2.175	2.859	1.905	2.270	2.983	1.478	1.870	2.611	1.566	1.971	2.741
200	1.798	2.143	2.816	1.865	2.222	2.921	1.450	1.837	2.570	1.524	1.923	2.679
250	1.780	2.121	2.788	1.839	2.191	2.880	1.431	1.815	2.542	1.496	1.891	2.638
300	1.767	2.106	2.767	1.820	2.169	2.850	1.417	1.800	2.522	1.476	1.868	2.608
∞	1.645	1.960	2.576	1.645	1.960	2.576	1.282	1.645	2.326	1.282	1.643	2.326

P.T.O.

Table A.7 Critical Values for Chi-Squared Distributions

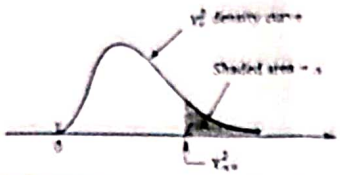

ν \ α	.995	.99	.975	.95	.90	.10	.05	.025	.01	.005
1	0.000	0.000	0.001	0.004	0.016	2.706	3.843	5.025	6.637	7.882
2	0.010	0.020	0.051	0.103	0.211	4.605	5.992	7.378	9.210	10.597
3	0.072	0.115	0.216	0.352	0.584	6.251	7.815	9.348	11.344	12.837
4	0.207	0.297	0.484	0.711	1.064	7.779	9.488	11.143	13.277	14.860
5	0.412	0.554	0.831	1.145	1.610	9.236	11.070	12.832	15.086	16.748
6	0.676	0.872	1.237	1.635	2.204	10.645	12.592	14.449	16.812	18.548
7	0.989	1.239	1.690	2.167	2.833	12.017	14.067	16.012	18.474	20.278
8	1.344	1.646	2.180	2.733	3.490	13.362	15.507	17.534	20.090	21.954
9	1.735	2.088	2.700	3.325	4.168	14.684	16.919	19.022	21.665	23.587
10	2.156	2.558	3.247	3.940	4.865	15.987	18.307	20.483	23.209	25.188
11	2.603	3.053	3.816	4.575	5.578	17.275	19.675	21.920	24.724	26.755
12	3.074	3.571	4.404	5.226	6.304	18.549	21.026	23.337	26.217	28.300
13	3.565	4.107	5.009	5.892	7.041	19.812	22.362	24.735	27.687	29.817
14	4.075	4.660	5.629	6.571	7.790	21.064	23.685	26.119	29.141	31.319
15	4.600	5.229	6.262	7.261	8.547	22.307	24.996	27.488	30.577	32.799
16	5.142	5.812	6.908	7.962	9.312	23.542	26.296	28.845	32.000	34.267
17	5.697	6.407	7.564	8.682	10.085	24.769	27.587	30.190	33.408	35.716
18	6.265	7.015	8.231	9.390	10.865	25.989	28.869	31.526	34.805	37.156
19	6.843	7.632	8.906	10.117	11.651	27.203	30.143	32.852	36.190	38.580
20	7.434	8.260	9.591	10.851	12.443	28.412	31.410	34.170	37.566	39.997
21	8.033	8.897	10.283	11.591	13.240	29.615	32.670	35.478	38.930	41.399
22	8.643	9.542	10.982	12.338	14.042	30.813	33.924	36.781	40.289	42.796
23	9.260	10.195	11.688	13.090	14.848	32.007	35.172	38.075	41.637	44.179
24	9.886	10.856	12.401	13.848	15.659	33.196	36.415	39.364	42.980	45.558
25	10.519	11.523	13.120	14.611	16.473	34.381	37.652	40.646	44.313	46.925
26	11.160	12.198	13.844	15.379	17.292	35.563	38.885	41.923	45.642	48.290
27	11.807	12.878	14.573	16.151	18.114	36.741	40.113	43.194	46.962	49.642
28	12.461	13.565	15.308	16.928	18.939	37.916	41.337	44.461	48.278	50.993
29	13.120	14.256	16.147	17.708	19.768	39.087	42.557	45.772	49.586	52.333
30	13.787	14.954	16.791	18.493	20.599	40.256	43.773	46.979	50.892	53.672
31	14.457	15.655	17.538	19.280	21.433	41.422	44.985	48.231	52.190	55.000
32	15.134	16.362	18.291	20.072	22.271	42.585	46.194	49.480	53.486	56.328
33	15.814	17.073	19.046	20.866	23.110	43.745	47.400	50.724	54.774	57.646
34	16.501	17.789	19.806	21.664	23.952	44.903	48.602	51.966	56.061	58.964
35	17.191	18.508	20.569	22.465	24.796	46.059	49.802	53.203	57.340	60.272
36	17.887	19.233	21.336	23.269	25.643	47.212	50.998	54.437	58.619	61.581
37	18.584	19.960	22.105	24.075	26.492	48.363	52.192	55.667	59.891	62.880
38	19.289	20.691	22.878	24.884	27.343	49.513	53.384	56.896	61.162	64.181
39	19.994	21.425	23.654	25.695	28.196	50.660	54.572	58.119	62.426	65.473
40	20.706	22.164	24.433	26.509	29.050	51.805	55.758	59.342	63.691	66.766

For $\nu > 40$, $\chi^2_{\alpha,\nu} \approx \nu\left(1 - \frac{2}{9\nu} + z_\alpha\sqrt{\frac{2}{9\nu}}\right)^3$

Table A.8 t Curve Tail Areas

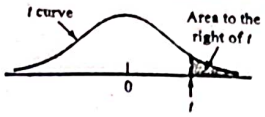

t \ ν	1	2	3	4	5	6	7	8	9	10	11	12	13	14	15	16	17	18
0.0	.500	.500	.500	.500	.500	.500	.500	.500	.500	.500	.500	.500	.500	.500	.500	.500	.500	.500
0.1	.468	.465	.463	.463	.462	.462	.462	.461	.461	.461	.461	.461	.461	.461	.461	.461	.461	.461
0.2	.437	.430	.427	.426	.425	.424	.424	.423	.423	.423	.423	.422	.422	.422	.422	.422	.422	.422
0.3	.407	.396	.392	.390	.388	.387	.386	.386	.386	.385	.385	.385	.384	.384	.384	.384	.384	.384
0.4	.379	.364	.358	.355	.353	.352	.351	.350	.349	.349	.348	.348	.348	.347	.347	.347	.347	.347
0.5	.352	.333	.326	.322	.319	.317	.316	.315	.315	.314	.313	.313	.313	.312	.312	.312	.312	.312
0.6	.328	.305	.295	.290	.287	.285	.284	.283	.282	.281	.280	.280	.279	.279	.279	.278	.278	.278
0.7	.306	.278	.267	.261	.258	.255	.253	.252	.251	.250	.249	.249	.248	.247	.247	.247	.247	.246
0.8	.285	.254	.241	.234	.230	.227	.225	.223	.222	.221	.220	.220	.219	.218	.218	.218	.217	.217
0.9	.267	.232	.217	.210	.205	.201	.199	.197	.196	.195	.194	.193	.192	.191	.191	.191	.190	.190
1.0	.250	.211	.196	.187	.182	.178	.175	.173	.172	.170	.169	.169	.168	.167	.167	.166	.166	.165
1.1	.235	.193	.176	.167	.162	.157	.154	.152	.150	.149	.147	.146	.146	.144	.144	.144	.143	.143
1.2	.221	.177	.158	.148	.142	.138	.135	.132	.130	.129	.128	.127	.126	.124	.124	.124	.123	.123
1.3	.209	.162	.142	.132	.125	.121	.117	.115	.113	.111	.110	.109	.108	.107	.107	.106	.105	.105
1.4	.197	.148	.128	.117	.110	.106	.102	.100	.098	.096	.095	.093	.092	.091	.091	.090	.090	.089
1.5	.187	.136	.115	.104	.097	.092	.089	.086	.084	.082	.081	.080	.079	.077	.077	.077	.076	.075
1.6	.178	.125	.104	.092	.085	.080	.077	.074	.072	.070	.069	.068	.067	.065	.065	.065	.064	.064
1.7	.169	.116	.094	.082	.075	.070	.065	.064	.062	.060	.059	.057	.056	.055	.055	.054	.054	.053
1.8	.161	.107	.085	.073	.066	.061	.057	.055	.053	.051	.050	.049	.048	.046	.046	.045	.045	.044
1.9	.154	.099	.077	.065	.058	.053	.050	.047	.045	.043	.042	.041	.040	.038	.038	.038	.037	.037
2.0	.148	.092	.070	.058	.051	.046	.043	.040	.038	.037	.035	.034	.033	.032	.032	.031	.031	.030
2.1	.141	.085	.063	.052	.045	.040	.037	.034	.033	.031	.030	.029	.028	.027	.027	.026	.025	.025
2.2	.136	.079	.058	.046	.040	.035	.032	.029	.028	.026	.025	.024	.023	.022	.022	.021	.021	.021
2.3	.131	.074	.052	.041	.035	.031	.027	.025	.023	.022	.021	.020	.019	.018	.018	.018	.017	.017
2.4	.126	.069	.048	.037	.031	.027	.024	.022	.020	.019	.018	.017	.016	.015	.015	.014	.014	.014
2.5	.121	.065	.044	.033	.027	.023	.020	.018	.017	.016	.015	.014	.013	.012	.012	.012	.011	.011
2.6	.117	.061	.040	.030	.024	.020	.018	.016	.014	.013	.012	.012	.011	.010	.010	.010	.009	.009
2.7	.113	.057	.037	.027	.021	.018	.015	.014	.012	.011	.010	.010	.009	.008	.008	.008	.008	.007
2.8	.109	.054	.034	.024	.019	.016	.013	.012	.010	.009	.009	.008	.008	.007	.007	.006	.006	.006
2.9	.106	.051	.031	.022	.017	.014	.011	.010	.009	.008	.007	.007	.006	.005	.005	.005	.005	.005
3.0	.102	.048	.029	.020	.015	.012	.010	.009	.007	.007	.006	.006	.005	.004	.004	.004	.004	.004
3.1	.099	.045	.027	.018	.013	.011	.009	.007	.006	.006	.005	.005	.004	.004	.004	.003	.003	.003
3.2	.096	.043	.025	.016	.012	.009	.008	.006	.005	.005	.004	.004	.003	.003	.003	.003	.003	.002
3.3	.094	.040	.023	.015	.011	.008	.007	.005	.005	.004	.004	.003	.003	.002	.002	.002	.002	.002
3.4	.091	.038	.021	.014	.010	.007	.006	.005	.004	.003	.003	.003	.002	.002	.002	.002	.002	.002
3.5	.089	.036	.020	.012	.009	.006	.005	.004	.003	.003	.002	.002	.002	.002	.002	.001	.001	.001
3.6	.086	.035	.018	.011	.008	.006	.004	.004	.003	.002	.002	.002	.002	.001	.001	.001	.001	.001
3.7	.084	.033	.017	.010	.007	.005	.004	.003	.002	.002	.002	.002	.001	.001	.001	.001	.001	.001
3.8	.082	.031	.016	.010	.006	.004	.003	.003	.002	.002	.001	.001	.001	.001	.001	.001	.001	.001
3.9	.080	.030	.015	.009	.006	.004	.003	.002	.002	.001	.001	.001	.001	.001	.001	.001	.001	.001
4.0	.078	.029	.014	.008	.005	.004	.003	.002	.002	.001	.001	.001	.001	.001	.001	.001	.000	.000

(*continued*)

Table A.8 t Curve Tail Areas *(cont.)*

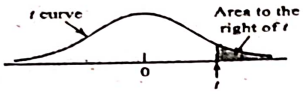

t \ ν	19	20	21	22	23	24	25	26	27	28	29	30	35	40	60	120	∞(=z)
0.0	.500	.500	.500	.500	.500	.500	.500	.500	.500	.500	.500	.500	.500	.500	.500	.500	.500
0.1	.461	.461	.461	.461	.461	.461	.461	.461	.461	.461	.461	.461	.460	.460	.460	.460	.460
0.2	.422	.422	.422	.422	.422	.422	.422	.422	.421	.421	.421	.421	.421	.421	.421	.421	.421
0.3	.384	.384	.384	.383	.383	.383	.383	.383	.383	.383	.383	.383	.383	.383	.383	.382	.382
0.4	.347	.347	.347	.347	.346	.346	.346	.346	.346	.346	.346	.346	.346	.346	.345	.345	.345
0.5	.311	.311	.311	.311	.311	.311	.311	.311	.311	.310	.310	.310	.310	.310	.309	.309	.309
0.6	.278	.278	.278	.277	.277	.277	.277	.277	.277	.277	.277	.277	.276	.276	.275	.275	.274
0.7	.246	.246	.246	.246	.245	.245	.245	.245	.245	.245	.245	.245	.244	.244	.243	.243	.242
0.8	.217	.217	.216	.216	.216	.216	.216	.215	.215	.215	.215	.215	.215	.214	.213	.213	.212
0.9	.190	.189	.189	.189	.189	.189	.188	.188	.188	.188	.188	.188	.187	.187	.186	.185	.184
1.0	.165	.165	.164	.164	.164	.164	.163	.163	.163	.163	.163	.163	.162	.162	.161	.160	.159
1.1	.143	.142	.142	.142	.141	.141	.141	.141	.141	.140	.140	.140	.139	.139	.138	.137	.136
1.2	.122	.122	.122	.121	.121	.121	.121	.120	.120	.120	.120	.120	.119	.119	.117	.116	.115
1.3	.105	.104	.104	.104	.103	.103	.103	.103	.102	.102	.102	.102	.101	.101	.099	.098	.097
1.4	.089	.089	.088	.088	.087	.087	.087	.087	.086	.086	.086	.086	.085	.085	.083	.082	.081
1.5	.075	.075	.074	.074	.074	.073	.073	.073	.073	.072	.072	.072	.071	.071	.069	.068	.067
1.6	.063	.063	.062	.062	.062	.061	.061	.061	.061	.060	.060	.060	.059	.059	.057	.056	.055
1.7	.053	.052	.052	.052	.051	.051	.051	.051	.050	.050	.050	.050	.049	.048	.047	.046	.045
1.8	.044	.043	.043	.043	.042	.042	.042	.042	.042	.041	.041	.041	.040	.040	.038	.037	.036
1.9	.036	.036	.036	.035	.035	.035	.035	.034	.034	.034	.034	.034	.033	.032	.031	.030	.029
2.0	.030	.030	.029	.029	.029	.028	.028	.028	.028	.028	.027	.027	.027	.026	.025	.024	.023
2.1	.025	.024	.024	.024	.023	.023	.023	.023	.023	.022	.022	.022	.022	.021	.020	.019	.018
2.2	.020	.020	.020	.019	.019	.019	.019	.018	.018	.018	.018	.018	.017	.017	.016	.015	.014
2.3	.016	.016	.016	.016	.015	.015	.015	.015	.015	.015	.014	.014	.014	.013	.012	.012	.011
2.4	.013	.013	.013	.013	.012	.012	.012	.012	.012	.012	.012	.011	.011	.011	.010	.009	.008
2.5	.011	.011	.010	.010	.010	.010	.010	.010	.009	.009	.009	.009	.009	.008	.008	.007	.006
2.6	.009	.009	.008	.008	.008	.008	.008	.008	.007	.007	.007	.007	.007	.007	.006	.005	.005
2.7	.007	.007	.007	.007	.006	.006	.006	.006	.006	.006	.006	.006	.005	.005	.004	.004	.003
2.8	.006	.006	.005	.005	.005	.005	.005	.005	.005	.005	.005	.004	.004	.004	.003	.003	.003
2.9	.005	.004	.004	.004	.004	.004	.004	.004	.004	.004	.004	.003	.003	.003	.003	.002	.002
3.0	.004	.004	.003	.003	.003	.003	.003	.003	.003	.003	.003	.003	.002	.002	.002	.002	.001
3.1	.003	.003	.003	.003	.003	.002	.002	.002	.002	.002	.002	.002	.002	.002	.001	.001	.001
3.2	.002	.002	.002	.002	.002	.002	.002	.002	.002	.002	.002	.002	.001	.001	.001	.001	.001
3.3	.002	.002	.002	.002	.002	.001	.001	.001	.001	.001	.001	.001	.001	.001	.001	.001	.000
3.4	.002	.001	.001	.001	.001	.001	.001	.001	.001	.001	.001	.001	.001	.001	.001	.000	.000
3.5	.001	.001	.001	.001	.001	.001	.001	.001	.001	.001	.001	.001	.001	.001	.000	.000	.000
3.6	.001	.001	.001	.001	.001	.001	.001	.001	.001	.001	.001	.001	.000	.000	.000	.000	.000
3.7	.001	.001	.001	.001	.001	.001	.001	.001	.000	.000	.000	.000	.000	.000	.000	.000	.000
3.8	.001	.001	.001	.000	.000	.000	.000	.000	.000	.000	.000	.000	.000	.000	.000	.000	.000
3.9	.000	.000	.000	.000	.000	.000	.000	.000	.000	.000	.000	.000	.000	.000	.000	.000	.000
4.0	.000	.000	.000	.000	.000	.000	.000	.000	.000	.000	.000	.000	.000	.000	.000	.000	.000

Table A.9 Critical Values for *F* Distributions

ν_2 = denominator df	α	ν_1 = numerator df: 1	2	3	4	5	6	7	8	9
1	.100	39.86	49.50	53.59	55.83	57.24	58.20	58.91	59.44	59.86
	.050	161.45	199.50	215.71	224.58	230.16	233.99	236.77	238.88	240.54
	.010	4052.20	4999.50	5403.40	5624.60	5763.60	5859.00	5928.40	5981.10	6022.50
	.001	405,284	500,000	540,379	562,500	576,405	585,937	592,873	598,144	602,284
2	.100	8.53	9.00	9.16	9.24	9.29	9.33	9.35	9.37	9.38
	.050	18.51	19.00	19.16	19.25	19.30	19.33	19.35	19.37	19.38
	.010	98.50	99.00	99.17	99.25	99.30	99.33	99.36	99.37	99.39
	.001	998.50	999.00	999.17	999.25	999.30	999.33	999.36	999.37	999.39
3	.100	5.54	5.46	5.39	5.34	5.31	5.28	5.27	5.25	5.24
	.050	10.13	9.55	9.28	9.12	9.01	8.94	8.89	8.85	8.81
	.010	34.12	30.82	29.46	28.71	28.24	27.91	27.67	27.49	27.35
	.001	167.03	148.50	141.11	137.10	134.58	132.85	131.58	130.62	129.86
4	.100	4.54	4.32	4.19	4.11	4.05	4.01	3.98	3.95	3.94
	.050	7.71	6.94	6.59	6.39	6.26	6.16	6.09	6.04	6.00
	.010	21.20	18.00	16.69	15.98	15.52	15.21	14.98	14.80	14.66
	.001	74.14	61.25	56.18	53.44	51.71	50.53	49.66	49.00	48.47
5	.100	4.06	3.78	3.62	3.52	3.45	3.40	3.37	3.34	3.32
	.050	6.61	5.79	5.41	5.19	5.05	4.95	4.88	4.82	4.77
	.010	16.26	13.27	12.06	11.39	10.97	10.67	10.46	10.29	10.16
	.001	47.18	37.12	33.20	31.09	29.75	28.83	28.16	27.65	27.24
6	.100	3.78	3.46	3.29	3.18	3.11	3.05	3.01	2.98	2.96
	.050	5.99	5.14	4.76	4.53	4.39	4.28	4.21	4.15	4.10
	.010	13.75	10.92	9.78	9.15	8.75	8.47	8.26	8.10	7.98
	.001	35.51	27.00	23.70	21.92	20.80	20.03	19.46	19.03	18.69
7	.100	3.59	3.26	3.07	2.96	2.88	2.83	2.78	2.75	2.72
	.050	5.59	4.74	4.35	4.12	3.97	3.87	3.79	3.73	3.68
	.010	12.25	9.55	8.45	7.85	7.46	7.19	6.99	6.84	6.72
	.001	29.25	21.69	18.77	17.20	16.21	15.52	15.02	14.63	14.33
8	.100	3.46	3.11	2.92	2.81	2.73	2.67	2.62	2.59	2.56
	.050	5.32	4.46	4.07	3.84	3.69	3.58	3.50	3.44	3.39
	.010	11.26	8.65	7.59	7.01	6.63	6.37	6.18	6.03	5.91
	.001	25.41	18.49	15.83	14.39	13.48	12.86	12.40	12.05	11.77
9	.100	3.36	3.01	2.81	2.69	2.61	2.55	2.51	2.47	2.44
	.050	5.12	4.26	3.86	3.63	3.48	3.37	3.29	3.23	3.18
	.010	10.56	8.02	6.99	6.42	6.06	5.80	5.61	5.47	5.35
	.001	22.86	16.39	13.90	12.56	11.71	11.13	10.70	10.37	10.11
10	.100	3.29	2.92	2.73	2.61	2.52	2.46	2.41	2.38	2.35
	.050	4.96	4.10	3.71	3.48	3.33	3.22	3.14	3.07	3.02
	.010	10.04	7.56	6.55	5.99	5.64	5.39	5.20	5.06	4.94
	.001	21.04	14.91	12.55	11.28	10.48	9.93	9.52	9.20	8.96
11	.100	3.23	2.86	2.66	2.54	2.45	2.39	2.34	2.30	2.27
	.050	4.84	3.98	3.59	3.36	3.20	3.09	3.01	2.95	2.90
	.010	9.65	7.21	6.22	5.67	5.32	5.07	4.89	4.74	4.63
	.001	19.69	13.81	11.56	10.35	9.58	9.05	8.66	8.35	8.12
12	.100	3.18	2.81	2.61	2.48	2.39	2.33	2.28	2.24	2.21
	.050	4.75	3.89	3.49	3.26	3.11	3.00	2.91	2.85	2.80
	.010	9.33	6.93	5.95	5.41	5.06	4.82	4.64	4.50	4.39
	.001	18.64	12.97	10.80	9.63	8.89	8.38	8.00	7.71	7.48

(*continued*)

Table A.9 Critical Values for *F* Distributions *(cont.)*

ν_1 = numerator df										
10	12	15	20	25	30	40	50	60	120	1000
60.19	60.71	61.22	61.74	62.05	62.26	62.53	62.69	62.79	63.06	63.30
241.88	243.91	245.95	248.01	249.26	250.10	251.14	251.77	252.20	253.25	254.19
6055.80	6106.30	6157.30	6208.70	6239.80	6260.60	6286.80	6302.50	6313.00	6339.40	6362.70
605,621	610,668	615,764	620,908	624,017	626,099	628,712	630,285	631,337	633,972	636,301
9.39	9.41	9.42	9.44	9.45	9.46	9.47	9.47	9.47	9.48	9.49
19.40	19.41	19.43	19.45	19.46	19.46	19.47	19.48	19.48	19.49	19.49
99.40	99.42	99.43	99.45	99.46	99.47	99.47	99.48	99.48	99.49	99.50
999.40	999.42	999.43	999.45	999.46	999.47	999.47	999.48	999.48	999.49	999.50
5.23	5.22	5.20	5.18	5.17	5.17	5.16	5.15	5.15	5.14	5.13
8.79	8.74	8.70	8.66	8.63	8.62	8.59	8.58	8.57	8.55	8.53
27.23	27.05	26.87	26.69	26.58	26.50	26.41	26.35	26.32	26.22	26.14
129.25	128.32	127.37	126.42	125.84	125.45	124.96	124.66	124.47	123.97	123.53
3.92	3.90	3.87	3.84	3.83	3.82	3.80	3.80	3.79	3.78	3.76
5.96	5.91	5.86	5.80	5.77	5.75	5.72	5.70	5.69	5.66	5.63
14.55	14.37	14.20	14.02	13.91	13.84	13.75	13.69	13.65	13.56	13.47
48.05	47.41	46.76	46.10	45.70	45.43	45.09	44.88	44.75	44.40	44.09
3.30	3.27	3.24	3.21	3.19	3.17	3.16	3.15	3.14	3.12	3.11
4.74	4.68	4.62	4.56	4.52	4.50	4.46	4.44	4.43	4.40	4.37
10.05	9.89	9.72	9.55	9.45	9.38	9.29	9.24	9.20	9.11	9.03
26.92	26.42	25.91	25.39	25.08	24.87	24.60	24.44	24.33	24.06	23.82
2.94	2.90	2.87	2.84	2.81	2.80	2.78	2.77	2.76	2.74	2.72
4.06	4.00	3.94	3.87	3.83	3.81	3.77	3.75	3.74	3.70	3.67
7.87	7.72	7.56	7.40	7.30	7.23	7.14	7.09	7.06	6.97	6.89
18.41	17.99	17.56	17.12	16.85	16.67	16.44	16.31	16.21	15.98	15.77
2.70	2.67	2.63	2.59	2.57	2.56	2.54	2.52	2.51	2.49	2.47
3.64	3.57	3.51	3.44	3.40	3.38	3.34	3.32	3.30	3.27	3.23
6.62	6.47	6.31	6.16	6.06	5.99	5.91	5.86	5.82	5.74	5.66
14.08	13.71	13.32	12.93	12.69	12.53	12.33	12.20	12.12	11.91	11.72
2.54	2.50	2.46	2.42	2.40	2.38	2.36	2.35	2.34	2.32	2.30
3.35	3.28	3.22	3.15	3.11	3.08	3.04	3.02	3.01	2.97	2.93
5.81	5.67	5.52	5.36	5.26	5.20	5.12	5.07	5.03	4.95	4.87
11.54	11.19	10.84	10.48	10.26	10.11	9.92	9.80	9.73	9.53	9.36
2.42	2.38	2.34	2.30	2.27	2.25	2.23	2.22	2.21	2.18	2.16
3.14	3.07	3.01	2.94	2.89	2.86	2.83	2.80	2.79	2.75	2.71
5.26	5.11	4.96	4.81	4.71	4.65	4.57	4.52	4.48	4.40	4.32
9.89	9.57	9.24	8.90	8.69	8.55	8.37	8.26	8.19	8.00	7.84
2.32	2.28	2.24	2.20	2.17	2.16	2.13	2.12	2.11	2.08	2.06
2.98	2.91	2.85	2.77	2.73	2.70	2.66	2.64	2.62	2.58	2.54
4.85	4.71	4.56	4.41	4.31	4.25	4.17	4.12	4.08	4.00	3.92
8.75	8.45	8.13	7.80	7.60	7.47	7.30	7.19	7.12	6.94	6.78
2.25	2.21	2.17	2.12	2.10	2.08	2.05	2.04	2.03	2.00	1.98
2.85	2.79	2.72	2.65	2.60	2.57	2.53	2.51	2.49	2.45	2.41
4.54	4.40	4.25	4.10	4.01	3.94	3.86	3.81	3.78	3.69	3.61
7.92	7.63	7.32	7.01	6.81	6.68	6.52	6.42	6.35	6.18	6.02
2.19	2.15	2.10	2.06	2.03	2.01	1.99	1.97	1.96	1.93	1.91
2.75	2.69	2.62	2.54	2.50	2.47	2.43	2.40	2.38	2.34	2.30
4.30	4.16	4.01	3.86	3.76	3.70	3.62	3.57	3.54	3.45	3.37
7.29	7.00	6.71	6.40	6.22	6.09	5.93	5.83	5.76	5.59	5.44

(continued)

Table A.9 Critical Values for F Distributions (cont.)

ν_2 = denominator df	α	ν_1 = numerator df: 1	2	3	4	5	6	7	8	9
13	.100	3.14	2.76	2.56	2.43	2.35	2.28	2.23	2.20	2.16
	.050	4.67	3.81	3.41	3.18	3.03	2.92	2.83	2.77	2.71
	.010	9.07	6.70	5.74	5.21	4.86	4.62	4.44	4.30	4.19
	.001	17.82	12.31	10.21	9.07	8.35	7.86	7.49	7.21	6.98
14	.100	3.10	2.73	2.52	2.39	2.31	2.24	2.19	2.15	2.12
	.050	4.60	3.74	3.34	3.11	2.96	2.85	2.76	2.70	2.65
	.010	8.86	6.51	5.56	5.04	4.69	4.46	4.28	4.14	4.03
	.001	17.14	11.78	9.73	8.62	7.92	7.44	7.08	6.80	6.58
15	.100	3.07	2.70	2.49	2.36	2.27	2.21	2.16	2.12	2.09
	.050	4.54	3.68	3.29	3.06	2.90	2.79	2.71	2.64	2.59
	.010	8.68	6.36	5.42	4.89	4.56	4.32	4.14	4.00	3.89
	.001	16.59	11.34	9.34	8.25	7.57	7.09	6.74	6.47	6.26
16	.100	3.05	2.67	2.46	2.33	2.24	2.18	2.13	2.09	2.06
	.050	4.49	3.63	3.24	3.01	2.85	2.74	2.66	2.59	2.54
	.010	8.53	6.23	5.29	4.77	4.44	4.20	4.03	3.89	3.78
	.001	16.12	10.97	9.01	7.94	7.27	6.80	6.46	6.19	5.98
17	.100	3.03	2.64	2.44	2.31	2.22	2.15	2.10	2.06	2.03
	.050	4.45	3.59	3.20	2.96	2.81	2.70	2.61	2.55	2.49
	.010	8.40	6.11	5.19	4.67	4.34	4.10	3.93	3.79	3.68
	.001	15.72	10.66	8.73	7.68	7.02	6.56	6.22	5.96	5.75
18	.100	3.01	2.62	2.42	2.29	2.20	2.13	2.08	2.04	2.00
	.050	4.41	3.55	3.16	2.93	2.77	2.66	2.58	2.51	2.46
	.010	8.29	6.01	5.09	4.58	4.25	4.01	3.84	3.71	3.60
	.001	15.38	10.39	8.49	7.46	6.81	6.35	6.02	5.76	5.56
19	.100	2.99	2.61	2.40	2.27	2.18	2.11	2.06	2.02	1.98
	.050	4.38	3.52	3.13	2.90	2.74	2.63	2.54	2.48	2.42
	.010	8.18	5.93	5.01	4.50	4.17	3.94	3.77	3.63	3.52
	.001	15.08	10.16	8.28	7.27	6.62	6.18	5.85	5.59	5.39
20	.100	2.97	2.59	2.38	2.25	2.16	2.09	2.04	2.00	1.96
	.050	4.35	3.49	3.10	2.87	2.71	2.60	2.51	2.45	2.39
	.010	8.10	5.85	4.94	4.43	4.10	3.87	3.70	3.56	3.46
	.001	14.82	9.95	8.10	7.10	6.46	6.02	5.69	5.44	5.24
21	.100	2.96	2.57	2.36	2.23	2.14	2.08	2.02	1.98	1.95
	.050	4.32	3.47	3.07	2.84	2.68	2.57	2.49	2.42	2.37
	.010	8.02	5.78	4.87	4.37	4.04	3.81	3.64	3.51	3.40
	.001	14.59	9.77	7.94	6.95	6.32	5.88	5.56	5.31	5.11
22	.100	2.95	2.56	2.35	2.22	2.13	2.06	2.01	1.97	1.93
	.050	4.30	3.44	3.05	2.82	2.66	2.55	2.46	2.40	2.34
	.010	7.95	5.72	4.82	4.31	3.99	3.76	3.59	3.45	3.35
	.001	14.38	9.61	7.80	6.81	6.19	5.76	5.44	5.19	4.99
23	.100	2.94	2.55	2.34	2.21	2.11	2.05	1.99	1.95	1.92
	.050	4.28	3.42	3.03	2.80	2.64	2.53	2.44	2.37	2.32
	.010	7.88	5.66	4.76	4.26	3.94	3.71	3.54	3.41	3.30
	.001	14.20	9.47	7.67	6.70	6.08	5.65	5.33	5.09	4.89
24	.100	2.93	2.54	2.33	2.19	2.10	2.04	1.98	1.94	1.91
	.050	4.26	3.40	3.01	2.78	2.62	2.51	2.42	2.36	2.30
	.010	7.82	5.61	4.72	4.22	3.90	3.67	3.50	3.36	3.26
	.001	14.03	9.34	7.55	6.59	5.98	5.55	5.23	4.99	4.80

(continued)

Table A.9 Critical Values for *F* Distributions (cont.)

ν_1 = numerator df										
10	12	15	20	25	30	40	50	60	120	1000
2.14	2.10	2.05	2.01	1.98	1.96	1.93	1.92	1.90	1.88	1.85
2.67	2.60	2.53	2.46	2.41	2.38	2.34	2.31	2.30	2.25	2.21
4.10	3.96	3.82	3.66	3.57	3.51	3.43	3.38	3.34	3.25	3.13
6.80	6.52	6.23	5.93	5.75	5.63	5.47	5.37	5.30	5.14	4.99
2.10	2.05	2.01	1.96	1.93	1.91	1.89	1.87	1.86	1.83	1.80
2.60	2.53	2.46	2.39	2.34	2.31	2.27	2.24	2.22	2.18	2.14
3.94	3.80	3.66	3.51	3.41	3.35	3.27	3.22	3.18	3.09	3.02
6.40	6.13	5.85	5.56	5.38	5.25	5.10	5.00	4.94	4.77	4.62
2.06	2.02	1.97	1.92	1.89	1.87	1.85	1.83	1.82	1.79	1.76
2.54	2.48	2.40	2.33	2.28	2.25	2.20	2.18	2.16	2.11	2.07
3.80	3.67	3.52	3.37	3.28	3.21	3.13	3.08	3.05	2.96	2.88
6.08	5.81	5.54	5.25	5.07	4.95	4.80	4.70	4.64	4.47	4.33
2.03	1.99	1.94	1.89	1.86	1.84	1.81	1.79	1.78	1.75	1.72
2.49	2.42	2.35	2.28	2.23	2.19	2.15	2.12	2.11	2.06	2.02
3.69	3.55	3.41	3.26	3.16	3.10	3.02	2.97	2.93	2.84	2.76
5.81	5.55	5.27	4.99	4.82	4.70	4.54	4.45	4.39	4.23	4.08
2.00	1.96	1.91	1.86	1.83	1.81	1.78	1.76	1.75	1.72	1.69
2.45	2.38	2.31	2.23	2.18	2.15	2.10	2.08	2.06	2.01	1.97
3.59	3.46	3.31	3.16	3.07	3.00	2.92	2.87	2.83	2.75	2.66
5.58	5.32	5.05	4.78	4.60	4.48	4.33	4.24	4.18	4.02	3.87
1.98	1.93	1.89	1.84	1.80	1.78	1.75	1.74	1.72	1.69	1.66
2.41	2.34	2.27	2.19	2.14	2.11	2.06	2.04	2.02	1.97	1.92
3.51	3.37	3.23	3.08	2.98	2.92	2.84	2.78	2.75	2.66	2.58
5.39	5.13	4.87	4.59	4.42	4.30	4.15	4.06	4.00	3.84	3.69
1.96	1.91	1.86	1.81	1.78	1.76	1.73	1.71	1.70	1.67	1.64
2.38	2.31	2.23	2.16	2.11	2.07	2.03	2.00	1.98	1.93	1.88
3.43	3.30	3.15	3.00	2.91	2.84	2.76	2.71	2.67	2.58	2.50
5.22	4.97	4.70	4.43	4.26	4.14	3.99	3.90	3.84	3.68	3.53
1.94	1.89	1.84	1.79	1.76	1.74	1.71	1.69	1.68	1.64	1.61
2.35	2.28	2.20	2.12	2.07	2.04	1.99	1.97	1.95	1.90	1.85
3.37	3.23	3.09	2.94	2.84	2.78	2.69	2.64	2.61	2.52	2.43
5.08	4.82	4.56	4.29	4.12	4.00	3.86	3.77	3.70	3.54	3.40
1.92	1.87	1.83	1.78	1.74	1.72	1.69	1.67	1.66	1.62	1.59
2.32	2.25	2.18	2.10	2.05	2.01	1.96	1.94	1.92	1.87	1.82
3.31	3.17	3.03	2.88	2.79	2.72	2.64	2.58	2.55	2.46	2.37
4.95	4.70	4.44	4.17	4.00	3.88	3.74	3.64	3.58	3.42	3.28
1.90	1.86	1.81	1.76	1.73	1.70	1.67	1.65	1.64	1.60	1.57
2.30	2.23	2.15	2.07	2.02	1.98	1.94	1.91	1.89	1.84	1.79
3.26	3.12	2.98	2.83	2.73	2.67	2.58	2.53	2.50	2.40	2.32
4.83	4.58	4.33	4.06	3.89	3.78	3.63	3.54	3.48	3.32	3.17
1.89	1.84	1.80	1.74	1.71	1.69	1.66	1.64	1.62	1.59	1.55
2.27	2.20	2.13	2.05	2.00	1.96	1.91	1.88	1.85	1.81	1.76
3.21	3.07	2.93	2.78	2.69	2.62	2.54	2.48	2.45	2.35	2.27
4.73	4.48	4.23	3.96	3.79	3.68	3.53	3.44	3.38	3.22	3.08
1.88	1.83	1.78	1.73	1.70	1.67	1.64	1.62	1.61	1.57	1.54
2.25	2.18	2.11	2.03	1.97	1.94	1.89	1.86	1.84	1.79	1.74
3.17	3.03	2.89	2.74	2.64	2.58	2.49	2.44	2.40	2.31	2.22
4.64	4.39	4.14	3.87	3.71	3.59	3.45	3.36	3.29	3.14	2.99

(continued)

Table A.9 Critical Values for *F* Distributions *(cont.)*

ν_2 = denominator df	α	ν_1 = numerator df: 1	2	3	4	5	6	7	8	9
25	.100	2.92	2.53	2.32	2.18	2.09	2.02	1.97	1.93	1.89
	.050	4.24	3.39	2.99	2.76	2.60	2.49	2.40	2.34	2.28
	.010	7.77	5.57	4.68	4.18	3.85	3.63	3.46	3.32	3.22
	.001	13.88	9.22	7.45	6.49	5.89	5.46	5.15	4.91	4.71
26	.100	2.91	2.52	2.31	2.17	2.08	2.01	1.96	1.92	1.88
	.050	4.23	3.37	2.98	2.74	2.59	2.47	2.39	2.32	2.27
	.010	7.72	5.53	4.64	4.14	3.82	3.59	3.42	3.29	3.18
	.001	13.74	9.12	7.36	6.41	5.80	5.38	5.07	4.83	4.64
27	.100	2.90	2.51	2.30	2.17	2.07	2.00	1.95	1.91	1.87
	.050	4.21	3.35	2.96	2.73	2.57	2.46	2.37	2.31	2.25
	.010	7.68	5.49	4.60	4.11	3.78	3.56	3.39	3.26	3.15
	.001	13.61	9.02	7.27	6.33	5.73	5.31	5.00	4.76	4.57
28	.100	2.89	2.50	2.29	2.16	2.06	2.00	1.94	1.90	1.87
	.050	4.20	3.34	2.95	2.71	2.56	2.45	2.36	2.29	2.24
	.010	7.64	5.45	4.57	4.07	3.75	3.53	3.36	3.23	3.12
	.001	13.50	8.93	7.19	6.25	5.66	5.24	4.93	4.69	4.50
29	.100	2.89	2.50	2.28	2.15	2.06	1.99	1.93	1.89	1.86
	.050	4.18	3.33	2.93	2.70	2.55	2.43	2.35	2.28	2.22
	.010	7.60	5.42	4.54	4.04	3.73	3.50	3.33	3.20	3.09
	.001	13.39	8.85	7.12	6.19	5.59	5.18	4.87	4.64	4.45
30	.100	2.88	2.49	2.28	2.14	2.05	1.98	1.93	1.88	1.85
	.050	4.17	3.32	2.92	2.69	2.53	2.42	2.33	2.27	2.21
	.010	7.56	5.39	4.51	4.02	3.70	3.47	3.30	3.17	3.07
	.001	13.29	8.77	7.05	6.12	5.53	5.12	4.82	4.58	4.39
40	.100	2.84	2.44	2.23	2.09	2.00	1.93	1.87	1.83	1.79
	.050	4.08	3.23	2.84	2.61	2.45	2.34	2.25	2.18	2.12
	.010	7.31	5.18	4.31	3.83	3.51	3.29	3.12	2.99	2.89
	.001	12.61	8.25	6.59	5.70	5.13	4.73	4.44	4.21	4.02
50	.100	2.81	2.41	2.20	2.06	1.97	1.90	1.84	1.80	1.76
	.050	4.03	3.18	2.79	2.56	2.40	2.29	2.20	2.13	2.07
	.010	7.17	5.06	4.20	3.72	3.41	3.19	3.02	2.89	2.78
	.001	12.22	7.96	6.34	5.46	4.90	4.51	4.22	4.00	3.82
60	.100	2.79	2.39	2.18	2.04	1.95	1.87	1.82	1.77	1.74
	.050	4.00	3.15	2.76	2.53	2.37	2.25	2.17	2.10	2.04
	.010	7.08	4.98	4.13	3.65	3.34	3.12	2.95	2.82	2.72
	.001	11.97	7.77	6.17	5.31	4.76	4.37	4.09	3.86	3.69
100	.100	2.76	2.36	2.14	2.00	1.91	1.83	1.78	1.73	1.69
	.050	3.94	3.09	2.70	2.46	2.31	2.19	2.10	2.03	1.97
	.010	6.90	4.82	3.98	3.51	3.21	2.99	2.82	2.69	2.59
	.001	11.50	7.41	5.86	5.02	4.48	4.11	3.83	3.61	3.44
200	.100	2.73	2.33	2.11	1.97	1.88	1.80	1.75	1.70	1.66
	.050	3.89	3.04	2.65	2.42	2.26	2.14	2.06	1.98	1.93
	.010	6.76	4.71	3.88	3.41	3.11	2.89	2.73	2.60	2.50
	.001	11.15	7.15	5.63	4.81	4.29	3.92	3.65	3.43	3.26
1000	.100	2.71	2.31	2.09	1.95	1.85	1.78	1.72	1.68	1.64
	.050	3.85	3.00	2.61	2.38	2.22	2.11	2.02	1.95	1.89
	.010	6.66	4.63	3.80	3.34	3.04	2.82	2.66	2.53	2.43
	.001	10.89	6.96	5.46	4.65	4.14	3.78	3.51	3.30	3.13

(continued)

Table A.9 Critical Values for *F* Distributions *(cont.)*

ν_1 = numerator df										
10	12	15	20	25	30	40	50	60	120	1000
1.87	1.82	1.77	1.72	1.68	1.66	1.63	1.61	1.59	1.56	1.52
2.24	2.16	2.09	2.01	1.96	1.92	1.87	1.84	1.82	1.77	1.72
3.13	2.99	2.85	2.70	2.60	2.54	2.45	2.40	2.36	2.27	2.18
4.56	4.31	4.06	3.79	3.63	3.52	3.37	3.28	3.22	3.06	2.91
1.86	1.81	1.76	1.71	1.67	1.65	1.61	1.59	1.58	1.54	1.51
2.22	2.15	2.07	1.99	1.94	1.90	1.85	1.82	1.80	1.75	1.70
3.09	2.96	2.81	2.66	2.57	2.50	2.42	2.36	2.33	2.23	2.14
4.48	4.24	3.99	3.72	3.56	3.44	3.30	3.21	3.15	2.99	2.84
1.85	1.80	1.75	1.70	1.66	1.64	1.60	1.58	1.57	1.53	1.50
2.20	2.13	2.06	1.97	1.92	1.88	1.84	1.81	1.79	1.73	1.68
3.06	2.93	2.78	2.63	2.54	2.47	2.38	2.33	2.29	2.20	2.11
4.41	4.17	3.92	3.66	3.49	3.38	3.23	3.14	3.08	2.92	2.78
1.84	1.79	1.74	1.69	1.65	1.63	1.59	1.57	1.56	1.52	1.48
2.19	2.12	2.04	1.96	1.91	1.87	1.82	1.79	1.77	1.71	1.66
3.03	2.90	2.75	2.60	2.51	2.44	2.35	2.30	2.26	2.17	2.08
4.35	4.11	3.86	3.60	3.43	3.32	3.18	3.09	3.02	2.86	2.72
1.83	1.78	1.73	1.68	1.64	1.62	1.58	1.56	1.55	1.51	1.47
2.18	2.10	2.03	1.94	1.89	1.85	1.81	1.77	1.75	1.70	1.65
3.00	2.87	2.73	2.57	2.48	2.41	2.33	2.27	2.23	2.14	2.05
4.29	4.05	3.80	3.54	3.38	3.27	3.12	3.03	2.97	2.81	2.66
1.82	1.77	1.72	1.67	1.63	1.61	1.57	1.55	1.54	1.50	1.46
2.16	2.09	2.01	1.93	1.88	1.84	1.79	1.76	1.74	1.68	1.63
2.98	2.84	2.70	2.55	2.45	2.39	2.30	2.25	2.21	2.11	2.02
4.24	4.00	3.75	3.49	3.33	3.22	3.07	2.98	2.92	2.76	2.61
1.76	1.71	1.66	1.61	1.57	1.54	1.51	1.48	1.47	1.42	1.38
2.08	2.00	1.92	1.84	1.78	1.74	1.69	1.66	1.64	1.58	1.52
2.80	2.66	2.52	2.37	2.27	2.20	2.11	2.06	2.02	1.92	1.82
3.87	3.64	3.40	3.14	2.98	2.87	2.73	2.64	2.57	2.41	2.25
1.73	1.68	1.63	1.57	1.53	1.50	1.46	1.44	1.42	1.38	1.33
2.03	1.95	1.87	1.78	1.73	1.69	1.63	1.60	1.58	1.51	1.45
2.70	2.56	2.42	2.27	2.17	2.10	2.01	1.95	1.91	1.80	1.70
3.67	3.44	3.20	2.95	2.79	2.68	2.53	2.44	2.38	2.21	2.05
1.71	1.66	1.60	1.54	1.50	1.48	1.44	1.41	1.40	1.35	1.30
1.99	1.92	1.84	1.75	1.69	1.65	1.59	1.56	1.53	1.47	1.40
2.63	2.50	2.35	2.20	2.10	2.03	1.94	1.88	1.84	1.73	1.62
3.54	3.32	3.08	2.83	2.67	2.55	2.41	2.32	2.25	2.08	1.92
1.66	1.61	1.56	1.49	1.45	1.42	1.38	1.35	1.34	1.28	1.22
1.93	1.85	1.77	1.68	1.62	1.57	1.52	1.48	1.45	1.38	1.30
2.50	2.37	2.22	2.07	1.97	1.89	1.80	1.74	1.69	1.57	1.45
3.30	3.07	2.84	2.59	2.43	2.32	2.17	2.08	2.01	1.83	1.64
1.63	1.58	1.52	1.46	1.41	1.38	1.34	1.31	1.29	1.23	1.16
1.88	1.80	1.72	1.62	1.56	1.52	1.46	1.41	1.39	1.30	1.21
2.41	2.27	2.13	1.97	1.87	1.79	1.69	1.63	1.58	1.45	1.30
3.12	2.90	2.67	2.42	2.26	2.15	2.00	1.90	1.83	1.64	1.43
1.61	1.55	1.49	1.43	1.38	1.35	1.30	1.27	1.25	1.18	1.08
1.84	1.76	1.68	1.58	1.52	1.47	1.41	1.36	1.33	1.24	1.11
2.34	2.20	2.06	1.90	1.79	1.72	1.61	1.54	1.50	1.35	1.16
2.99	2.77	2.54	2.30	2.14	2.02	1.87	1.77	1.69	1.49	1.22